Nama : Kelas :

Bilangan Bulat

Tentukan KPK dan FPB bilangan-bilangan dibawah menggunakan pohon faktor

1. 8 dan 12

8

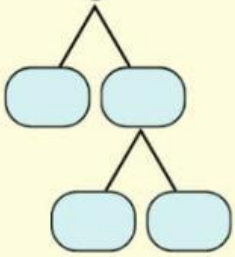

12

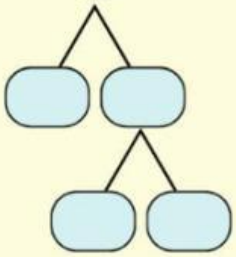

FPB : _____ **KPK :** _____

2. 18 dan 75

18

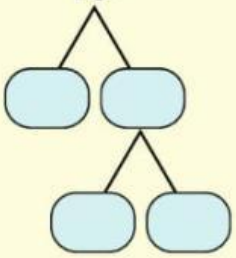

75

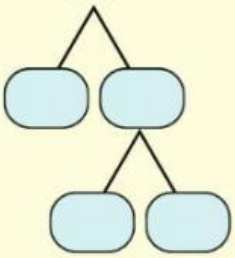

FPB : _____ **KPK :** _____

3. 24 dan 30

24

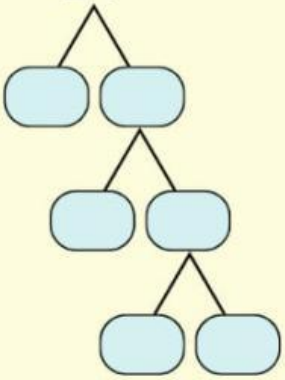

30

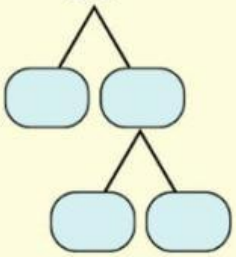

FPB : _____ **KPK :** _____

4. 60 dan 100

60

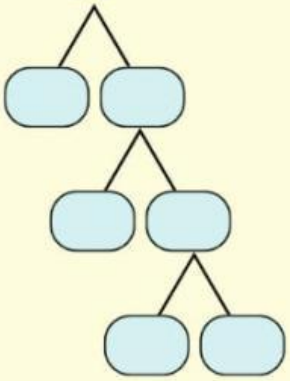

100

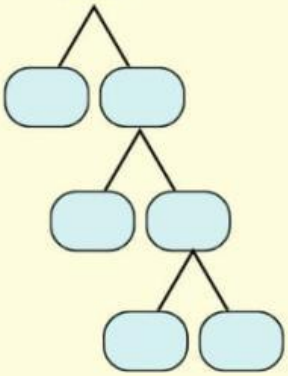

FPB : _____ **KPK :** _____

5. 56 dan 210

56

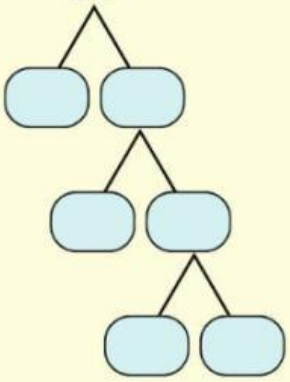

210

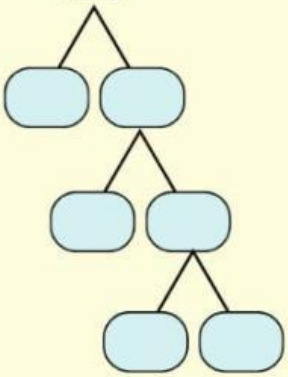

FPB : _____ **KPK :** _____

LIVEWORKSHEETS

Nama : Kelas :

Bilangan Bulat

Tentukan KPK dan FPB bilangan-bilangan dibawah menggunakan pohon faktor

1. 8 dan 12

8

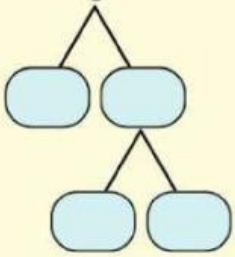

12

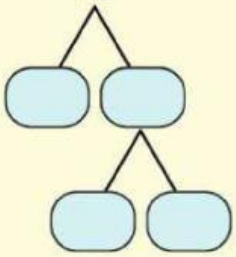

FPB : _____ **KPK :** _____

2. 18 dan 75

18

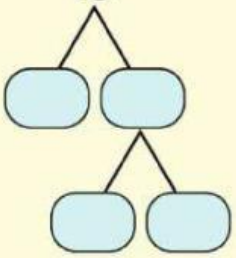

75

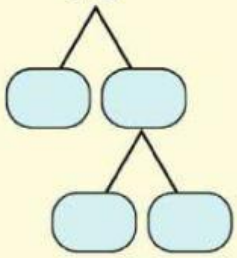

FPB : _____ **KPK :** _____

3. 24 dan 30

24

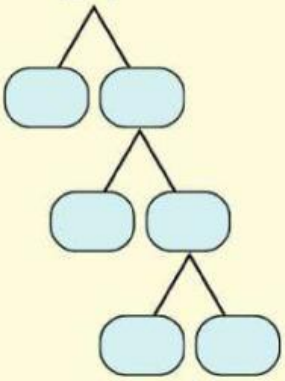

30

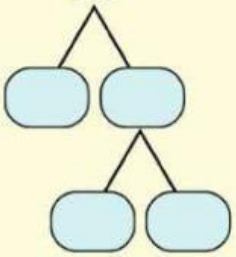

FPB : _____ **KPK :** _____

4. 60 dan 100

60

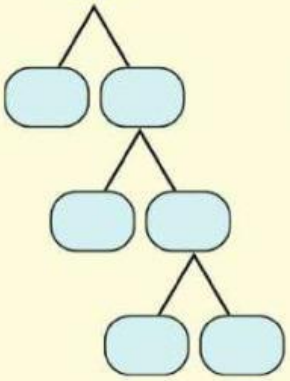

100

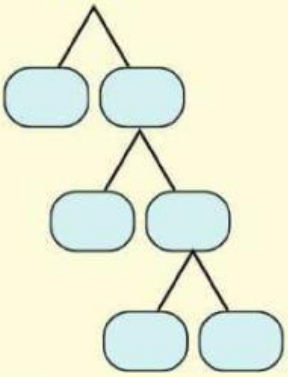

FPB : _____ **KPK :** _____

5. 56 dan 210

56

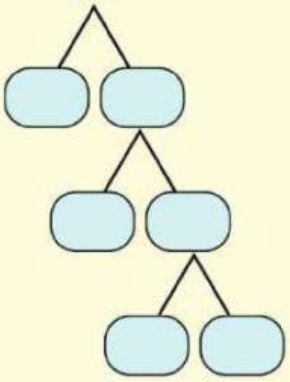

210

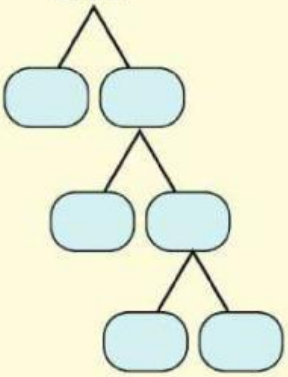

FPB : _____ **KPK :** _____

LIVEWORKSHEETS