LATIHAN

LIVEWORKSHEETS

Soal Segitiga Sama Kaki

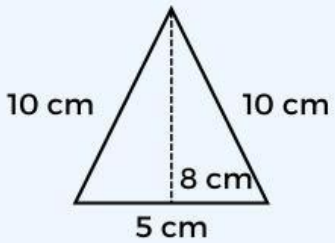

Berapakah keliling bangun datar tersebut?

20 25 30 35

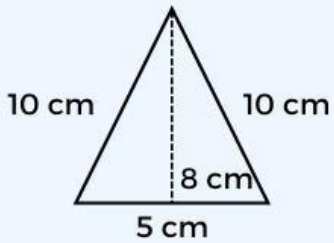

Berapakah luas bangun datar tersebut?

20 25 30 35

LIVEWORKSHEETS

Soal Trapesium

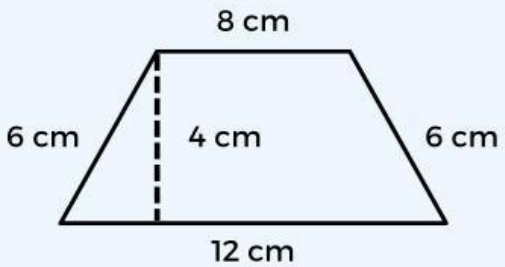

Berapakah keliling bangun datar tersebut?

18 32 30 35

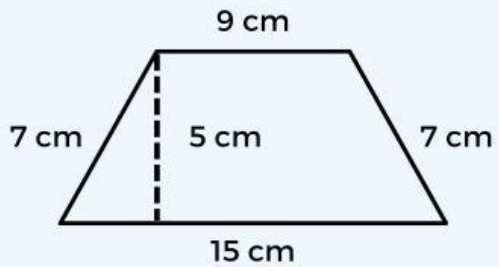

Berapakah luas bangun datar tersebut?

70 67 60 50

LIVEWORKSHEETS

Soal Jajar Genjang

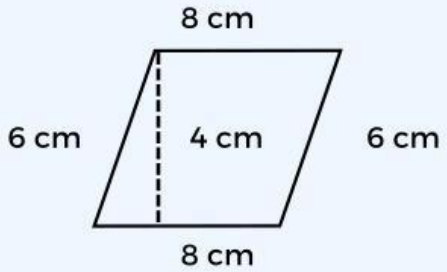

Berapakah keliling bangun datar tersebut?

28 32 30 35

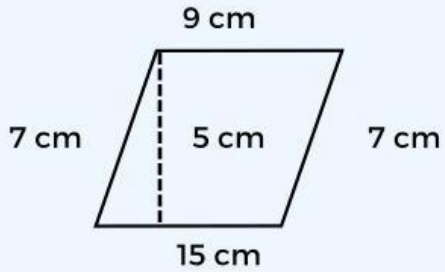

Berapakah luas bangun datar tersebut?

70 65 60 45

LIVEWORKSHEETS

Soal Persegi Panjang

Berapakah keliling bangun datar tersebut?

12 24 30 36

Berapakah luas bangun datar tersebut?

75 65 60 45

LIVEWORKSHEETS

Soal Persegi

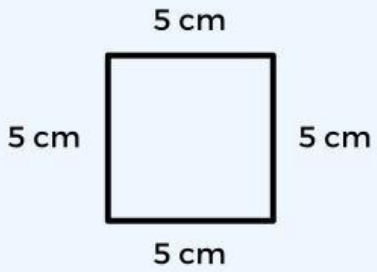

Berapakah keliling bangun datar tersebut?

20 25 30 36

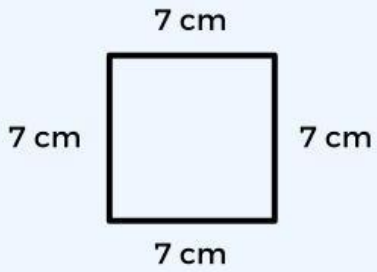

Berapakah luas bangun datar tersebut?

28 35 40 49

LIVEWORKSHEETS

Soal Belah Ketupat

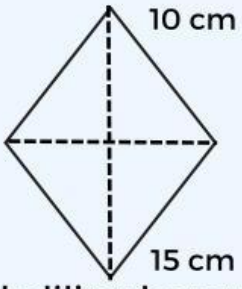

Berapakah keliling bangun datar tersebut?

10 | 15 | 25 | 30

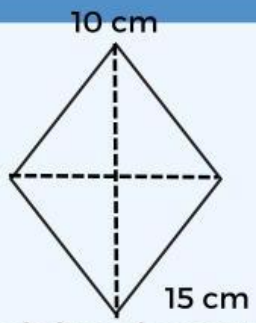

Berapakah luas bangun datar tersebut?

80 | 75 | 70 | 85

LIVEWORKSHEETS

Soal Belah Layang-layang

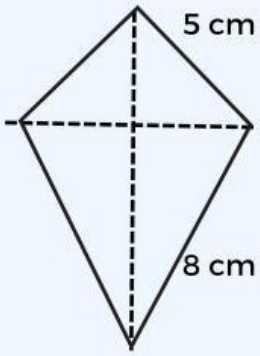

Berapakah keliling bangun datar tersebut?

26 | 30 | 36 | 40

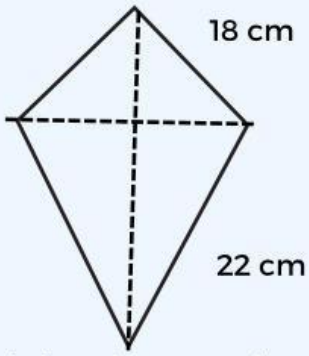

Berapakah luas bangun datar tersebut?

99 | 108 | 126 | 144

LIVEWORKSHEETS

Terima Kasih

LIVEWORKSHEETS