8. KLASS MATEMAATIKA TÖÖLEHT

Kolmnurga sisenurk ja välisnurk

① Leia nurga x suurus

1)

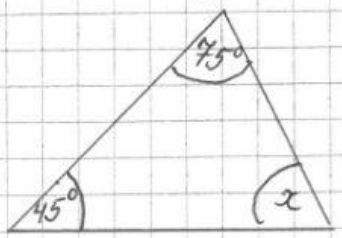

x = °

2)

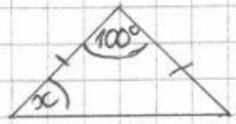

x = °

3)

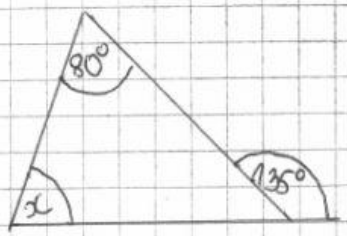

x = °

4)

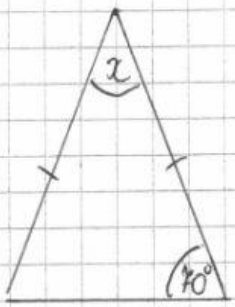

x = °

5)

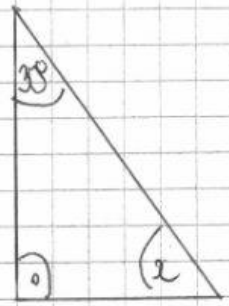

x = °

6)

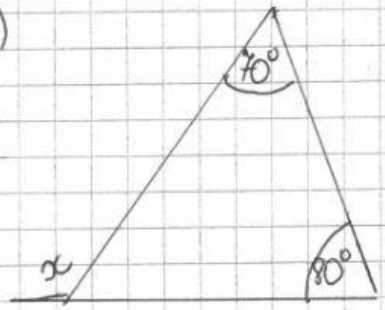

x = °

7)

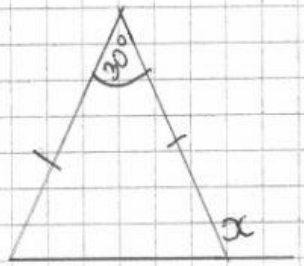

x = °

8)

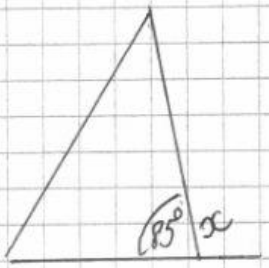

x = °

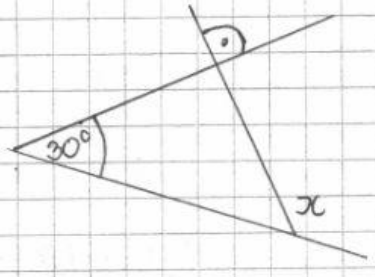

x = °

② Leia joonisilt kõik kreeka tähtedega märgitud nurgad

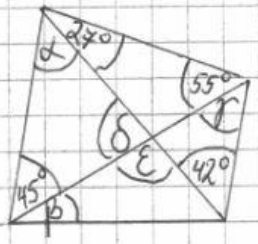

α = ° β = ° γ = °

δ = ° ε = °

LIVEWORKSHEETS