Kecacatan Penglihatan dan Cara Membetulkannya

1. Terdapat tiga jenis kecacatan penglihatan iaitu _____, _____ dan _____.

2. Lengkapkan ruangan di bawah.

a) Rabun Jauh Sebab rabun jauh: 1. Bebola mata terlalu_____. *Imej terbentuk di hadapan retina* 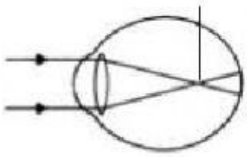 Objek _____ kelihatan kabur kerana imej terbentuk di _____ retina.	**b) Rabun Dekat** Sebab rabun dekat: 1. Bebola mata terlalu _____. 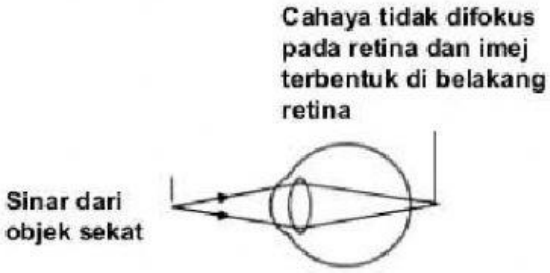 Objek _____ kelihatan kabur kerana imej terbentuk di _____ retina.
2. Kanta mata terlalu _____ 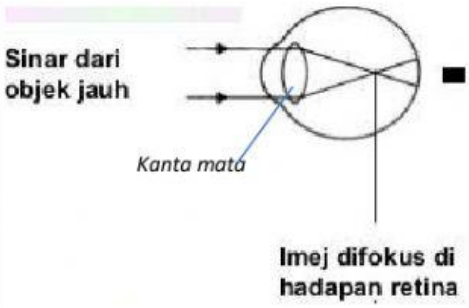 Cara atasi: Menggunakan cermin mata jenis kanta _____. 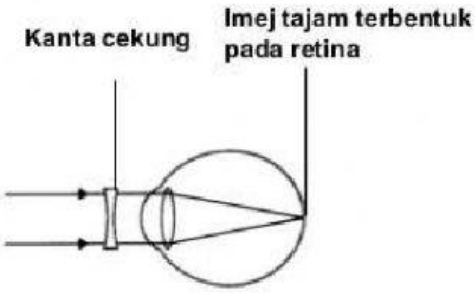	2. Kanta mata terlalu _____. 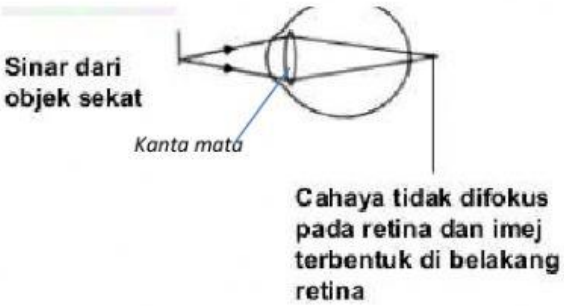 Cara atasi: Menggunakan cermin mata jenis kanta _____. 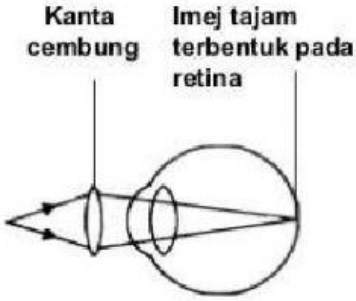

LIVEWORKSHEETS

LIVEWORKSHEETS