Nama: _____ Kelas: _____

Pejumlahan 1-10

Hubungkanlah dengan garis jumlah gambar yang sama banyaknya dengan hasil penjumlahan!

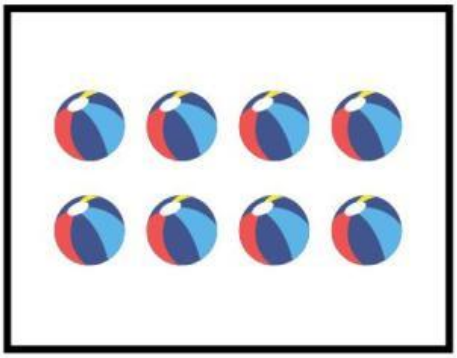



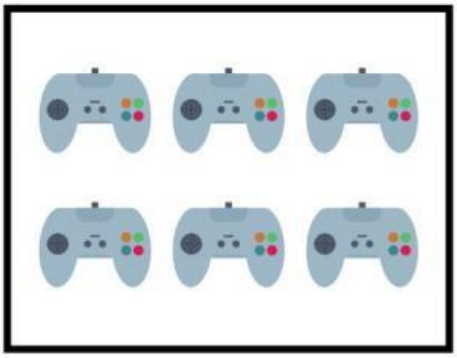

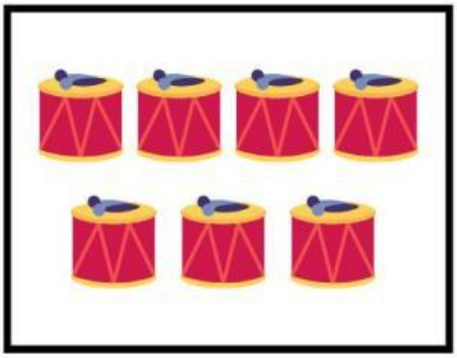

4+3

4+4

3+3

5+5

LIVEWORKSHEETS