Adding with number lines

Solve the following by drawing hops on the number line.

Example:

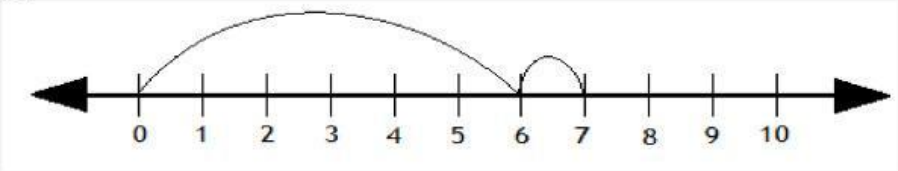

6 + 1 = 7

1.

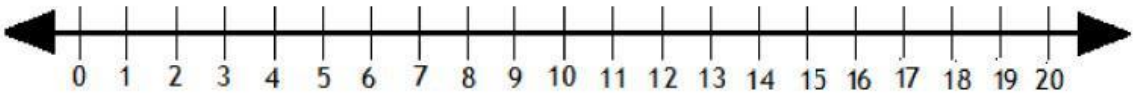

5 + 12 = ☐

2.

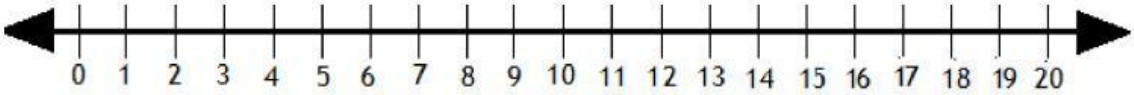

10 + 4 = ☐

3.

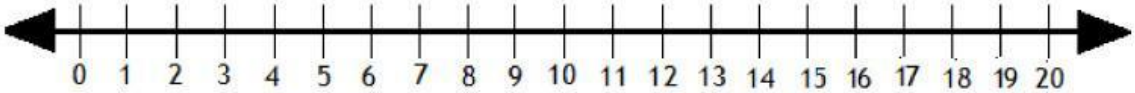

3+ 8 = ☐

4.

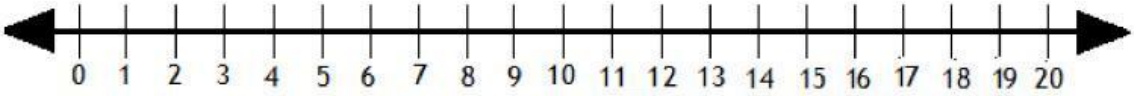

7 + 10 = ☐

LIVEWORKSHEETS