Adding with number lines

Solve the following by drawing hops on the number line.

Example:

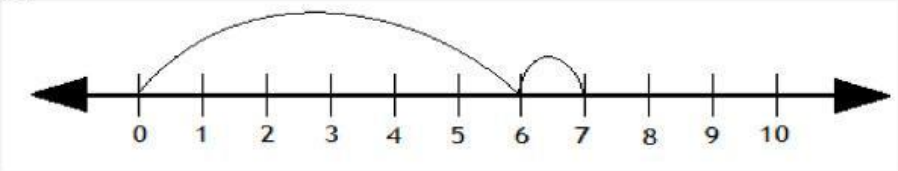

6 + 1 = 7

1.

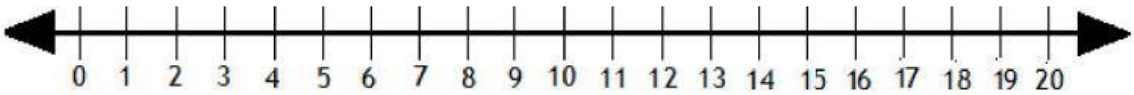

8 + 11 = ☐

2.

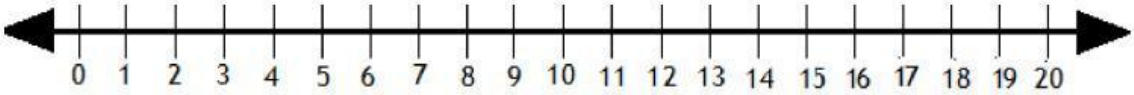

16 + 3 = ☐

3.

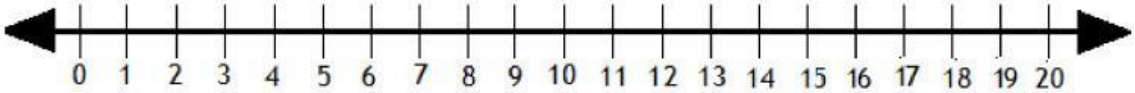

9 + 8 = ☐

4.

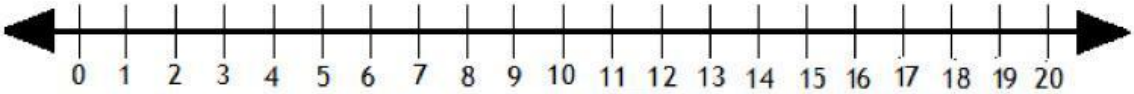

7 + 10 = ☐

LIVEWORKSHEETS