Adding with number lines

Solve the following by drawing hops on the number line.

Example:

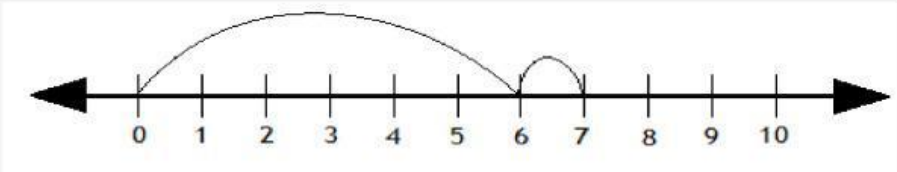

6 + 1 = 7

1.

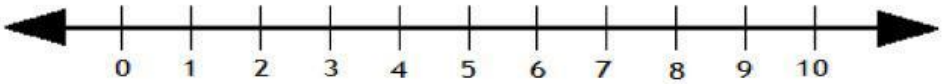

1 + 5 = ☐

2.

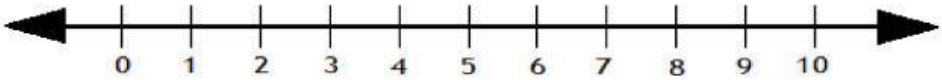

2 + 8 = ☐

3.

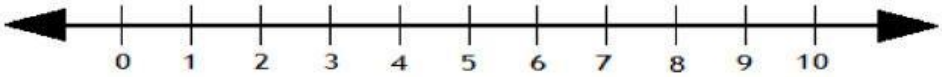

1 + 4 = ☐

4.

2 + 6 = ☐

LIVEWORKSHEETS