INSPIRED TOTS EARLY LEARNING CENTER
K5 FIRST TERM ASSESSMENT 2024/2025

Mathematics

1. Sorting is grouping of objects according to colors, shapes and sizes. True/False?
2. Count how many of each type there are according to their colours and write the correct answers in the boxes provided below.



LIVEWORKSHEETS

INSPIRED TOTS EARLY LEARNING CENTER
K5 FIRST TERM ASSESSMENT 2024/2025

3. In each row, sort and select shapes with same colors.



4. Tick the group that has more number of objects.

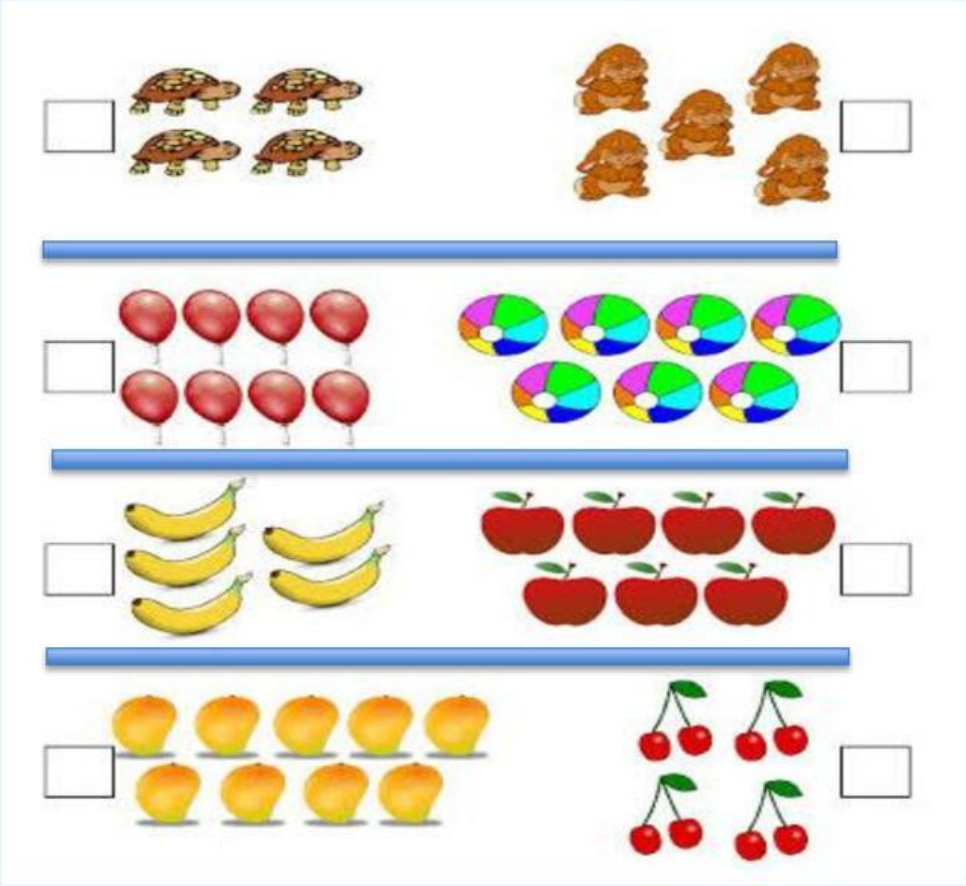

LIVEWORKSHEETS

INSPIRED TOTS EARLY LEARNING CENTER
K5 FIRST TERM ASSESSMENT 2024/2025

5. Tick the matching objects below.



6. Count the objects and write the correct numbers.

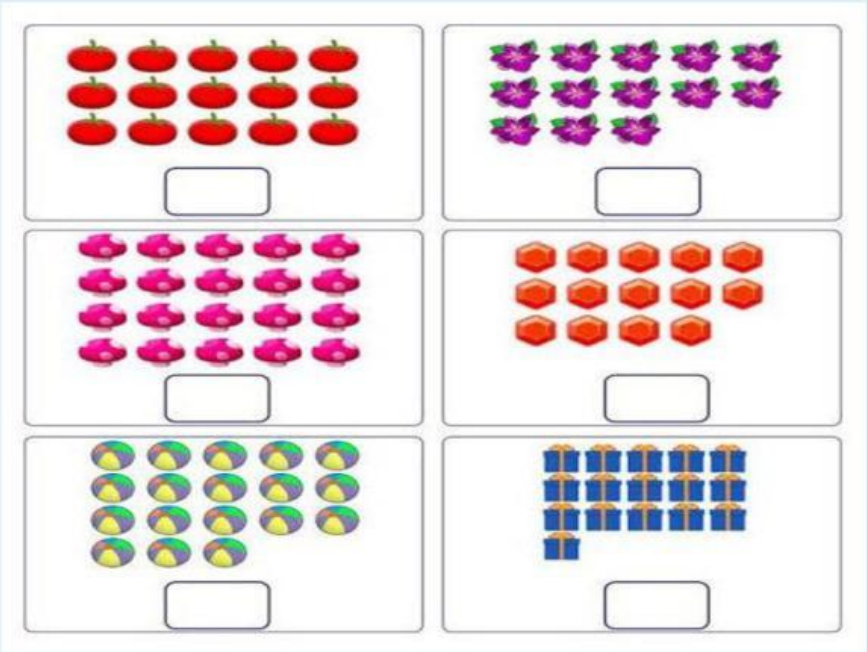

LIVEWORKSHEETS

INSPIRED TOTS EARLY LEARNING CENTER
K5 FIRST TERM ASSESSMENT 2024/2025

7. Draw a line from the shapes on the left to match the objects on the right.

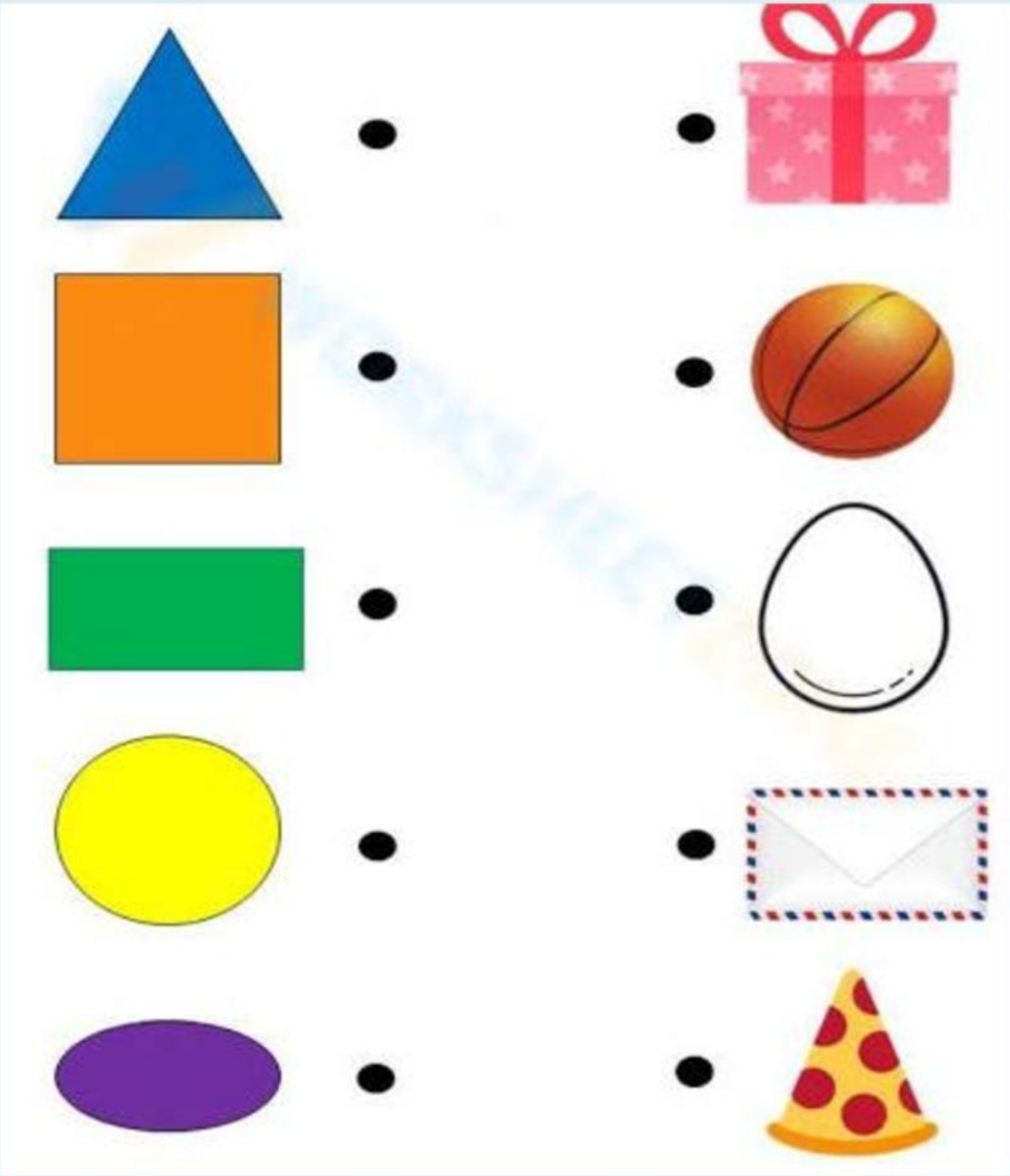

LIVEWORKSHEETS

INSPIRED TOTS EARLY LEARNING CENTER
K5 FIRST TERM ASSESSMENT 2024/2025

8. In the figures below, what number comes before or after the one given?
   a. After _____ comes 7.
   b. Before 9 comes _____.
   c. Before 6 comes _____.

9. Count and write the number of objects in figures.

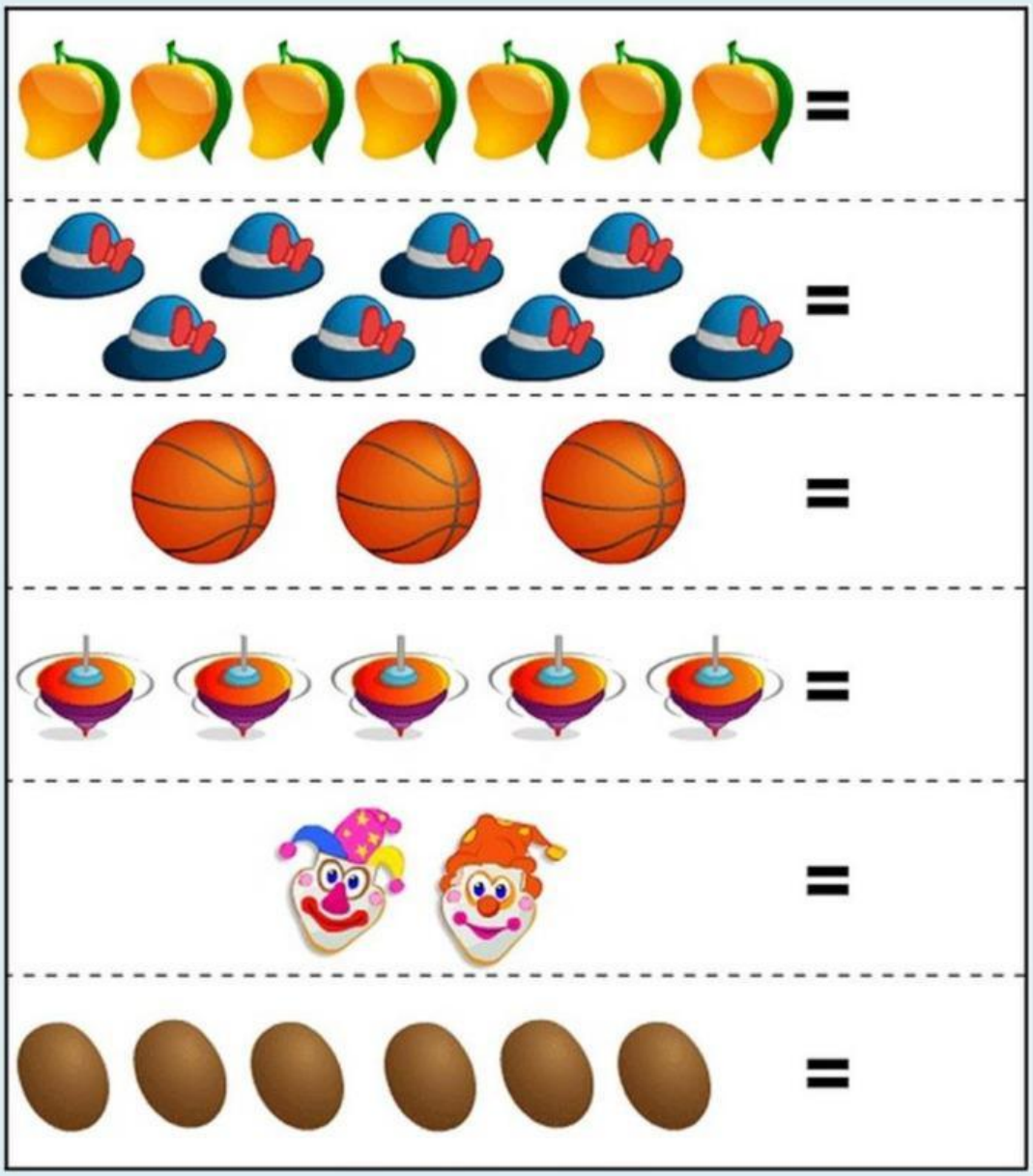

LIVEWORKSHEETS

INSPIRED TOTS EARLY LEARNING CENTER
K5 FIRST TERM ASSESSMENT 2024/2025

10. Sort the objects into 3 groups:

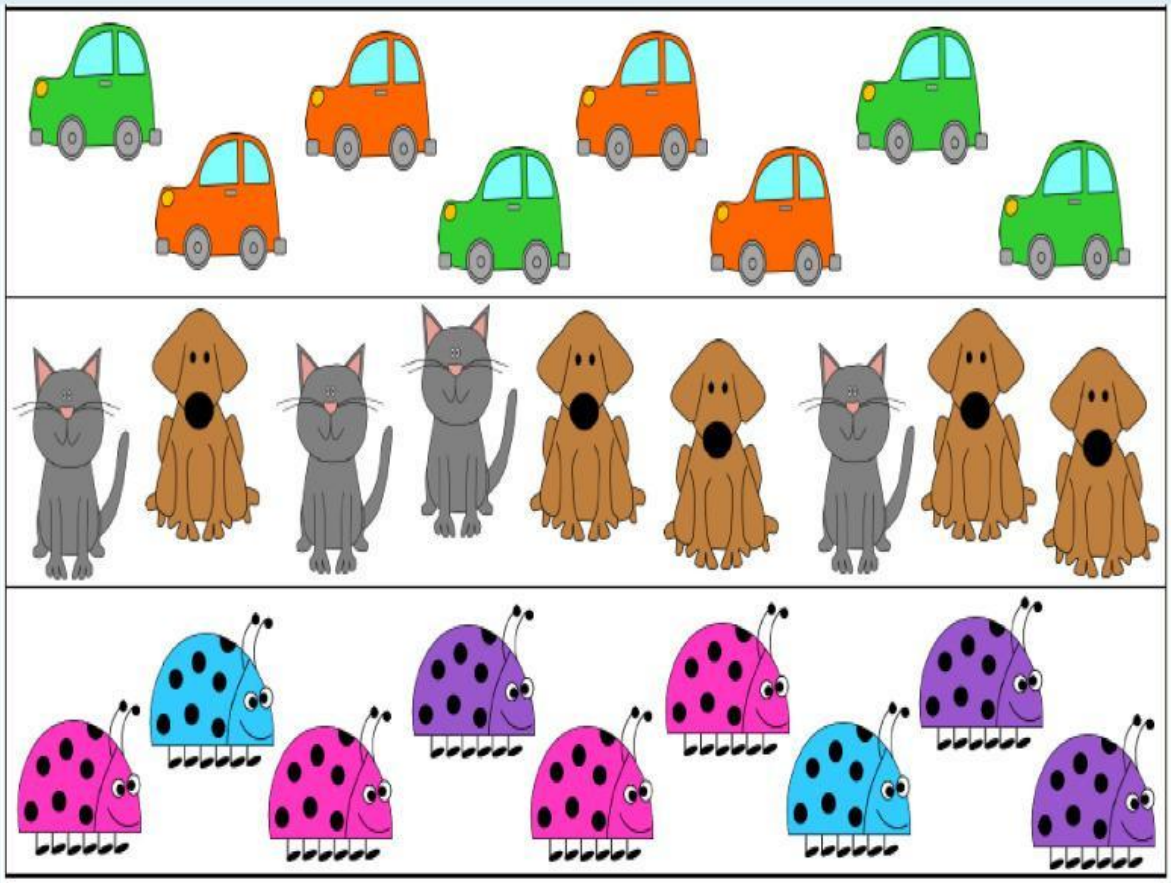

Complete by writing the answer in words.

a. How many objects are in Group A? _____.
b. How many objects are in Group B? _____.
c. How many objects are in Group C? _____.

11. Mention 5 solid shapes.

a. _____.
b. _____.
c. _____.
d. _____.
e. _____.

LIVEWORKSHEETS

INSPIRED TOTS EARLY LEARNING CENTER
K5 FIRST TERM ASSESSMENT 2024/2025

12. A cube has 6 faces and 12 edges. True/False?

13. A cuboid has _____ faces and _____ edges.
    a. 8,4
    b. 6,12
    c. 4,5
14. A cylinder has 3 faces. True/False?

15. A sphere has 1 surface. True/False?

16. A cube and a cuboid has how many corners?
    a. 8 b. 5 c. 6
17. Label correctly the solid shapes below.







LIVEWORKSHEETS

INSPIRED TOTS EARLY LEARNING CENTER
K5 FIRST TERM ASSESSMENT 2024/2025

18. Count and write the number of objects in words.

LIVEWORKSHEETS

19. Write the following figures below in words.

a. 1 _____.
b. 2 _____.
c. 3 _____.
d. 4 _____.
e. 5 _____.
f. 6 _____.
g. 7 _____.
h. 8 _____.
i. 9 _____.
j. 10 _____.

LIVEWORKSHEETS