3 класс.

Органы человека.

1.Подпиши название органов человека.
2.Укажи цифрами их место.

1 

2 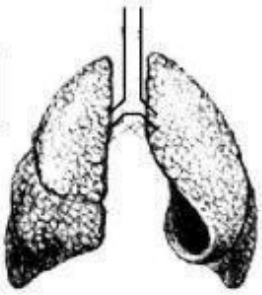

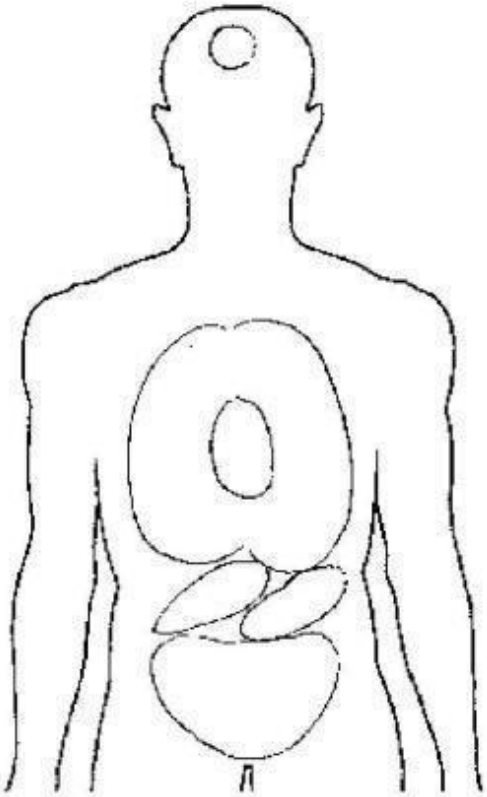

3

5

4

6

LIVEWORKSHEETS
mudryj-gnom.3dn.ru