Зургийг ажиглаад энгийн бутархайг гүйцээн бичээд аравтын бутархай болгоорой.

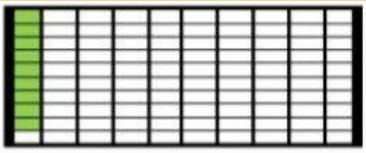

$\frac{\quad}{100} = \quad$



$\frac{\quad}{100} = \quad$

$\frac{\quad}{100} = \quad$

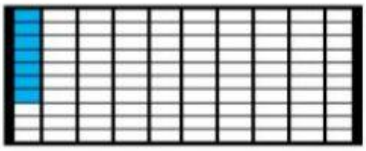

$\frac{\quad}{100} = \quad$



$\frac{\quad}{100} = \quad$

$\frac{\quad}{100} = \quad$

Хоосон нүдэнд тохирох тоог бичээрэй.

$\frac{4}{10} = \quad$

$\frac{\quad}{10} = 0.8$

$\frac{7}{100} = \quad$

$\frac{\quad}{100} = 0.75$

LIVEWORKSHEETS