MATHEMATICS

Attempt the following questions

Select all the options that represent the model below

1.

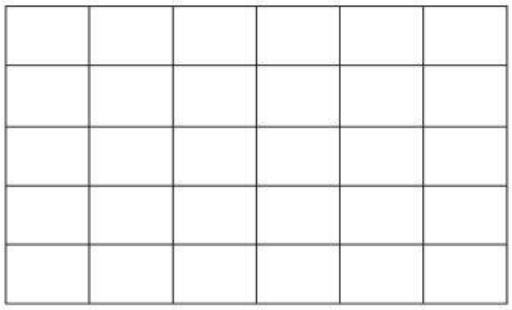

6 + 6 + 6 + 6 + 6 = 30

5 x 6 = 30

6 + 6 + 6 + 5 + 5 + 5 = 33

20 + 10 = 30

5 + 5 + 5 + 5 + 5 + 5 = 30

6 x 5 = 30

2.

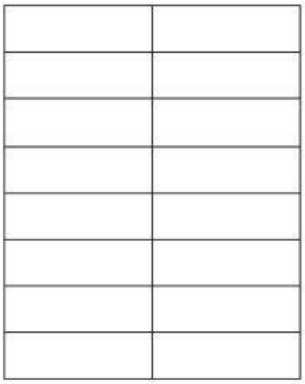

8 + 8 = 16

2 x 8 = 16

8 x 2 = 16

2 + 2 + 2 + 2 + 2 + 2 + 2 + 2 = 16

8 + 2 = 10

2 + 8 = 10

3.

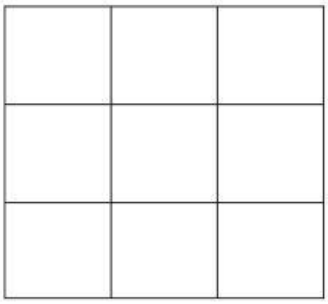

3 x 3 = 9

6 + 6 = 12

3 + 3 + 3 = 9

3 + 6 = 9

4.

2 x 5 = 10

5 + 5 + 5 = 15

2 + 2 + 2 + 2 + 2 = 10

5 x 3 = 15

5 + 5 = 10

LIVEWORKSHEETS

5. 

6 + 6 + 6 + 6 = 24

6 X 6 = 36

6 X 4 = 24

4 + 4 + 4 + 4 + 4 + 4 = 24

Select the correct answers represented by these number lines

6. 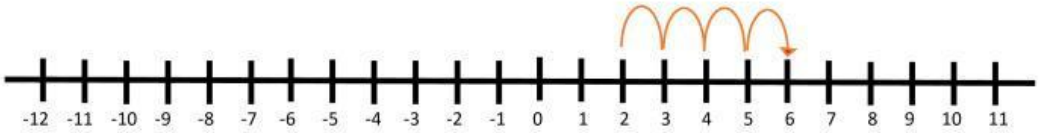

2 + 4 = 6 2 x 4 = 8 6 - 4 = 2 2 + 6 = 8

7. 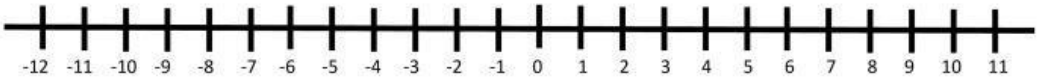

3 - 8 =

8. 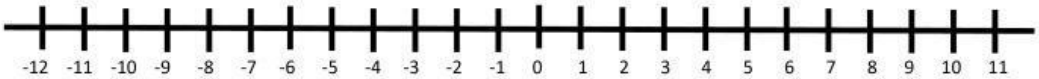

-7 + 5 =

9. 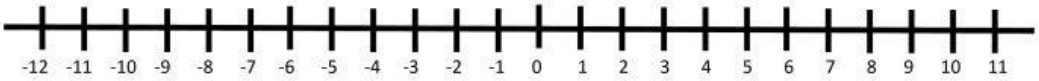

-11 + 13 =

10. 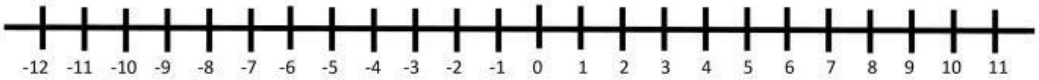

10 - 17 =

LIVEWORKSHEETS

11. A basket contains 42 apples. If you share these apples into six smaller baskets, how many apples will be put in each basket?

= apples will be in each basket

12. A basket contains 30 mangoes. If you share these mangoes into three smaller baskets, how many mangoes will be put in each basket?

= mangoes will be in each basket

13. Share a basket of 12 papayas among 4 boys. How many will each of them have?

= papayas will be for each boy

14. There are 345 tennis balls and 179 golf balls. What is the total number of balls?

	H	T	O

LIVEWORKSHEETS