LATIHAN MEMBACA ALAT UKUR

NO.	SOAL	JAWABAN

1

Pasangkan gambar alat ukur berikut dengan nama dan fungsinya.

Gambar Alat Ukur		
Nama		
Fungsi		
Gambar Alat Ukur		
Nama		
Fungsi		

Mikrometer Sekrup	Mengukur volume benda cair maupun padat
Neraca O'hauss	Mengukur diameter dalam, diameter luar, kedalaman, dan ketebalan benda
Jangka Sorong	Mengukur diameter dan ketebalan benda
Gelas Ukur	Mengukur massa benda

2

Pasangkan NST alat ukur berikut.

ALAT UKUR	NST
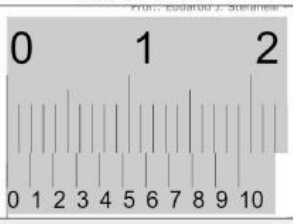	
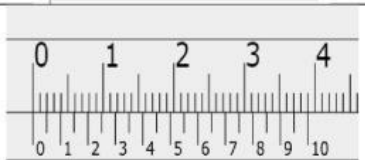	
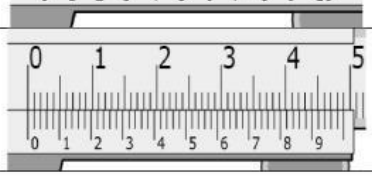	

PILIHAN JAWABAN	
0,005 mm	0,01 gram
0,002 cm	0,005 cm
0,01 cm	0,1 ml

LIVEWORKSHEETS

NO.	SOAL	JAWABAN
3	Berapakah NST alat ukur ini?	
4	Berapakah NST alat ukur ini?	
5	Berapakah NST alat ukur ini?	
6	Tuliskan hasil pembacaan pengukuran berikut sesuai dengan aturan penulisan pengukuran. ± ± 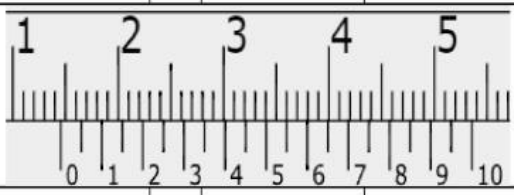 ± 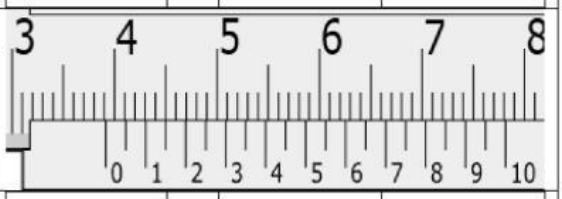 ±	
7	Tuliskan hasil pembacaan pengukuran berikut sesuai dengan aturan penulisan pengukuran. ± ± 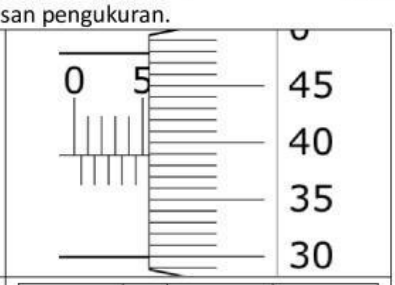 ± 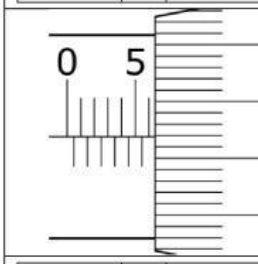 ± 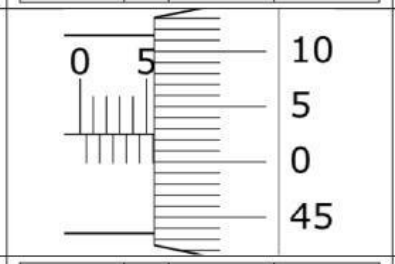 ± 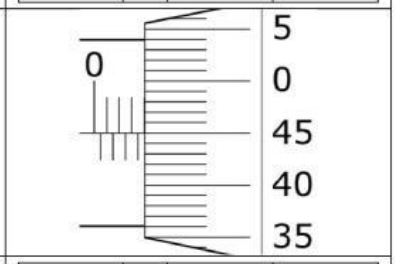 ±	

LIVEWORKSHEETS

NO.	SOAL	JAWABAN
8	Tuliskan hasil pembacaan pengukuran berikut sesuai dengan aturan penulisan pengukuran.	
	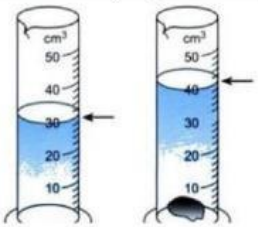 ±	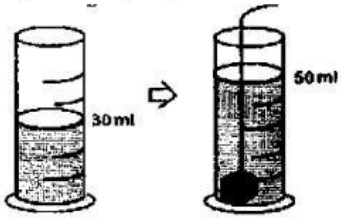 ±
	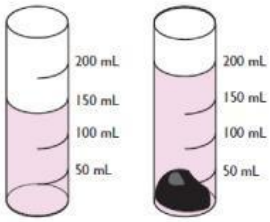 ±	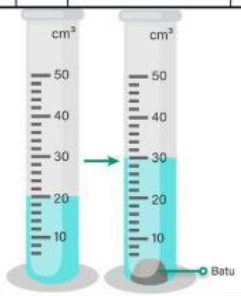 ±
9	Tuliskan hasil pembacaan pengukuran berikut sesuai dengan aturan penulisan pengukuran.	
	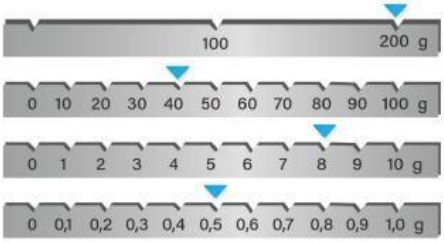 ±	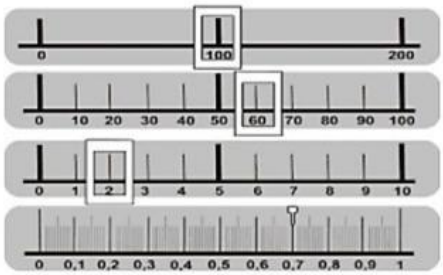 ±
	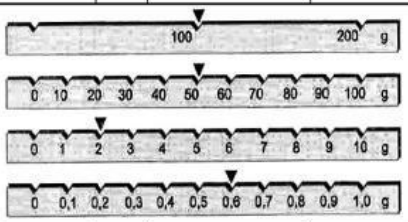 ±	
10	Pasangkan faktor kesalahan berikut dengan tepat.	

Pengamat lupa melakukan kalibrasi alat ukur sebelum mengukur.	Kesalahan sistematis
Terdapat kipas angin yang menyala di atas meja kerja praktikum.	Kesalahan random
Alat ukur terdapat karat pada bagian pemutar.	Kesalahan pengamat

LIVEWORKSHEETS