Lembar Kerja Peserta Didik

MATEMATIKA

Materi : Keliling dan Luas Bangun Datar



NAMA :

KELAS :

LIVEWORKSHEETS

Ayo Berlatih, (1)

Hitunglah keliling bangun datar berikut!

1.

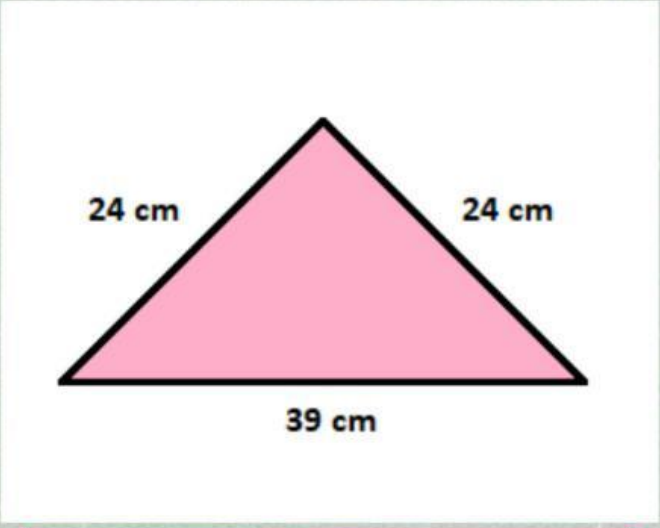

Keliling = ... cm

2.

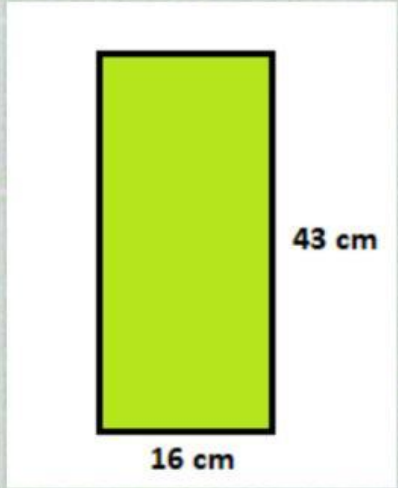

Keliling = ... cm

3.

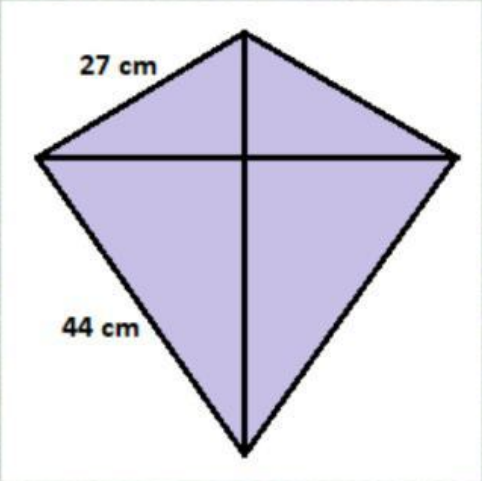

Keliling = ... cm

4.

Keliling = ... cm

LIVEWORKSHEETS

5.

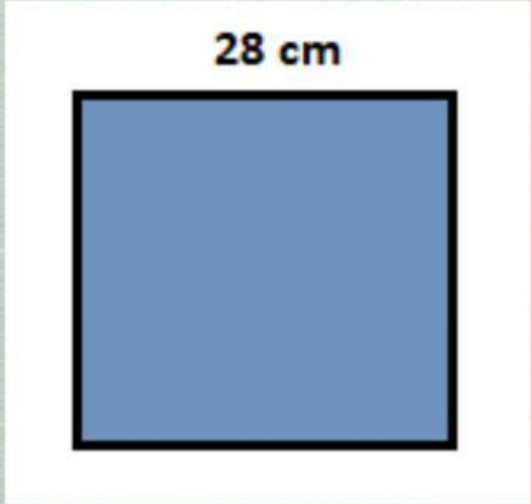

Keliling = ... cm

6.



Keliling = ... cm

7.

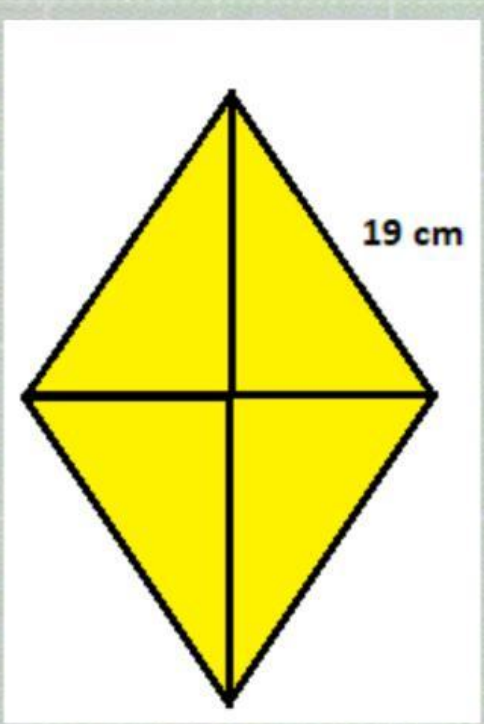

Keliling = ... cm

LIVEWORKSHEETS

Ayo Berlatih, (2)

Hitunglah luas bangun datar berikut!

1.

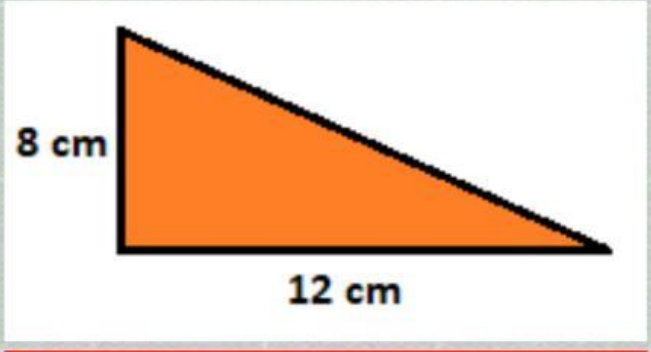

Luas = ... cm²

2.

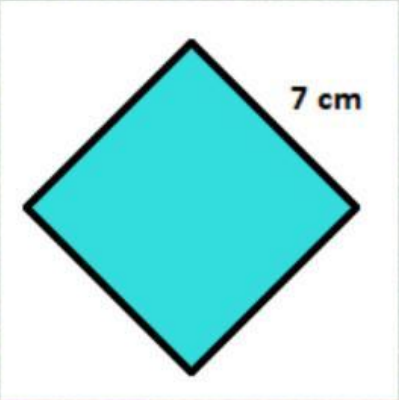

Luas = ... cm²

3.

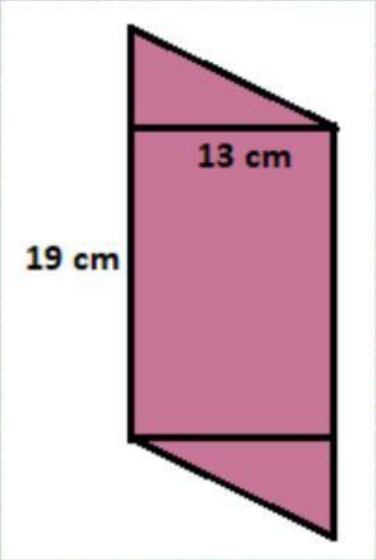

Luas = ... cm²

4.

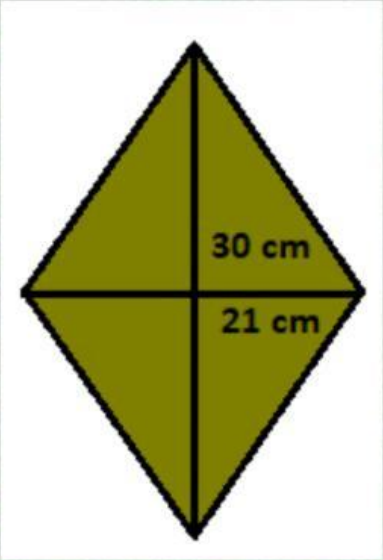

Luas = ... cm²

LIVEWORKSHEETS

Hitunglah luas bangun datar berikut!

5.

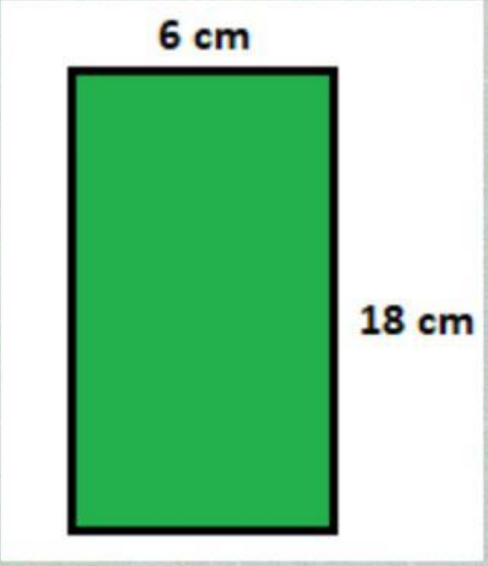

Luas = ... cm²

6.

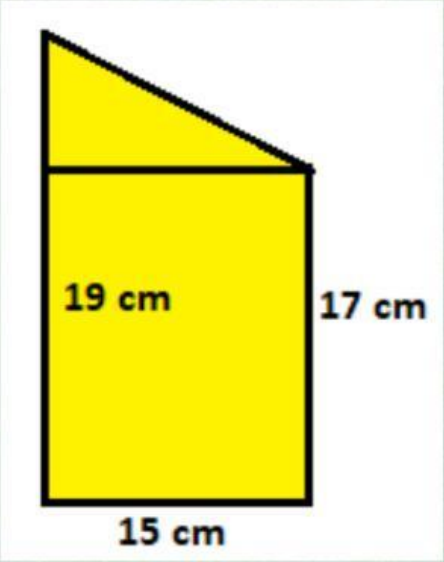

Luas = ... cm²

7.

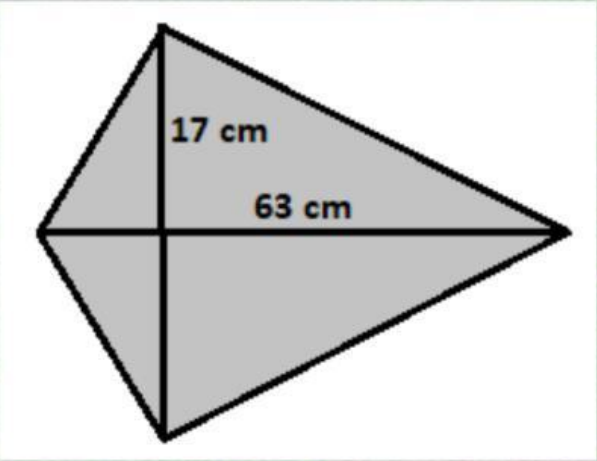

Luas = ... cm²

LIVEWORKSHEETS

Ayo Berlatih, (3)

Hitunglah keliling bangun datar gabungan berikut!

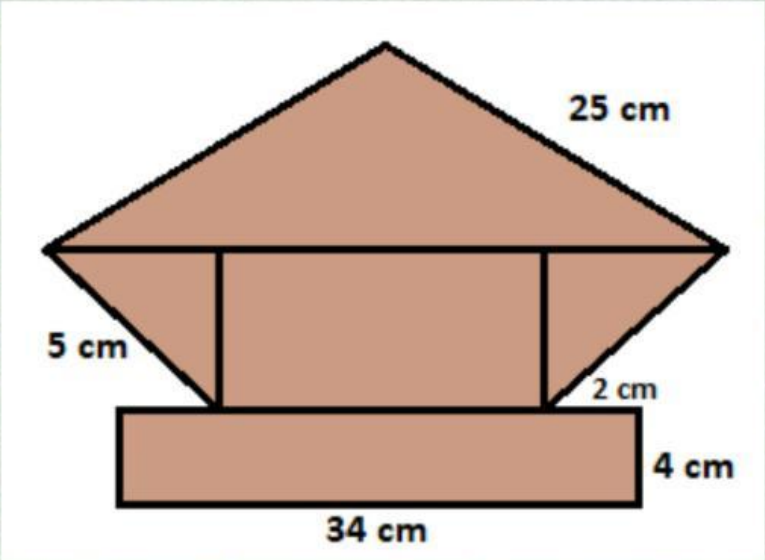

Keliling = ... cm

Hitunglah luas bangun datar gabungan berikut!

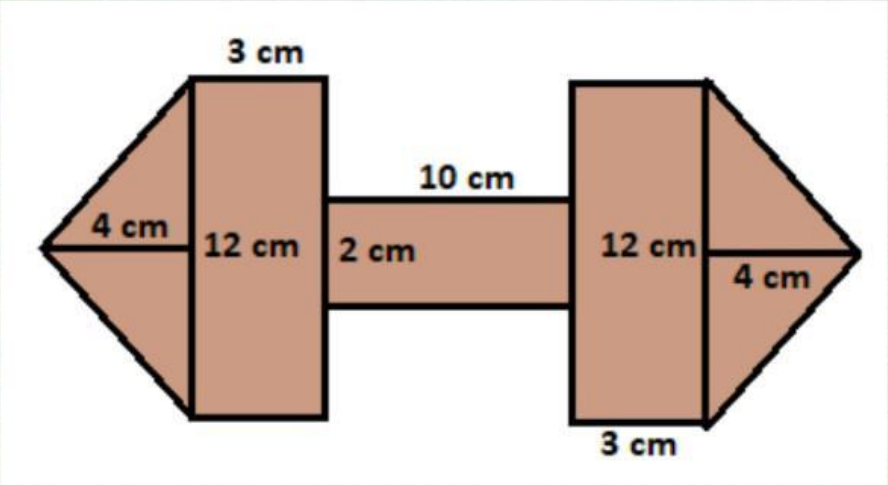

Luas = ... cm^2

LIVEWORKSHEETS

Ayo Berlatih, (4)

1. 7500 are = ____ hektare
2. 11 km^2 = ____ are
3. 10 hm^2 = ____ m^2
4. 400 mm^2 = ____ cm^2
5. 5.000 dm^2 = ____ ca
6. 16 hektare = ____ ca
7. 920.000 dm^2 = ____ are
8. 8.000 ca = ____ are
9. 60 cm^2 = ____ mm^2
10. 17 km^2 = ____ m^2

LIVEWORKSHEETS