MATEMATIKA KELAS 5

LKPD

SDN SUKAJAYA II

Di Susun Oleh :
TRI HANDAYANI, S.Pd

LIVEWORKSHEETS

PERHATIKAN VIDEO DIBAWAH INI

LIVEWORKSHEETS

Soal Tentang Hubungkan Gambar

Nama :
Kelas :
Tanggal :

Hubungkan gambar yang tepat Menggunakan garis sesuai aktivitas yang sering dilakukan sehari -hari !



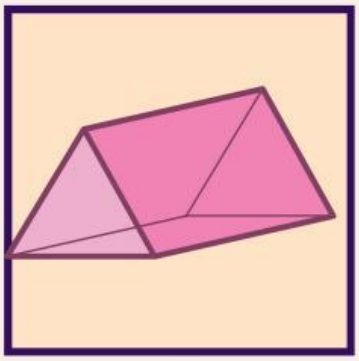





SEGITIGA

BOLA

BALOK

PRISMA

KUBUS

LIMAS

TABUNG

KERUCUT



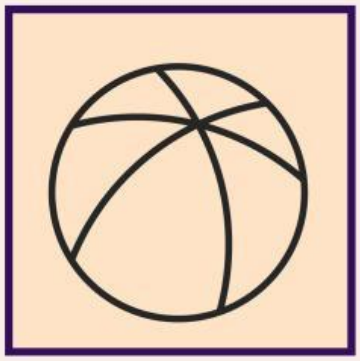





LIVEWORKSHEETS

A100

menghitung

Rumusn Volume





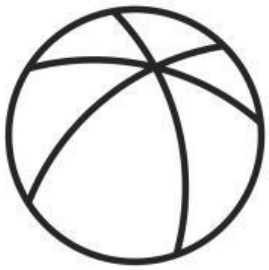



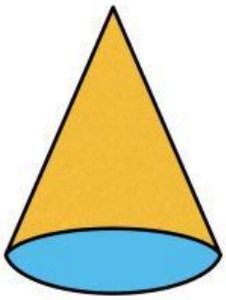

LIVEWORKSHEETS

A100 menghitung

Nama Bangun





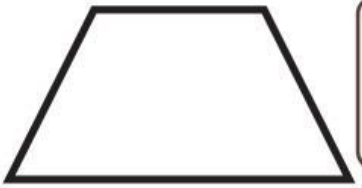

LIVEWORKSHEETS

A100

menghitung

Rumusn Luas





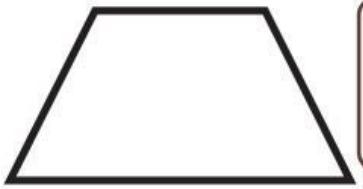

LIVEWORKSHEETS

MARI BERHITUNG

85.472 + 12.538?

75.643 –24.328?

100.000 – 64.325?

63.245 + 15.755?

45.372 +52.628?

86.540 – 45.320?

LIVEWORKSHEETS

MARI BERHITUNG

5,78 - 3,44 =

1,54 - 0,23 =

8,37 - 2,09 =

6,48-1,92 =

0,54 - 0,34 =

1,96 - 0,56 =

LIVEWORKSHEETS

MARI BERHITUNG

7,28 + 2,4 =

9,15 + 8,6 =

4 + 1,26 =

3,4 + 1,84 =

7,08 + 0,29 =

9, 15 + 8,6 =

LIVEWORKSHEETS