01 - DIVIDA IGUALMENTE A QUANTIDADE NA METADE.

02 - OBSERVE CADA QUADRO E RESPONDA:



A METADE DE 2 É _____



A METADE DE 6 É _____

A METADE DE 8 É _____

LIVEWORKSHEETS

A METADE DE 4 É _____

A METADE DE 12 É _____

03 - QUANTOS PIRULITOS CADA CRIANÇA IRÁ RECEBER?

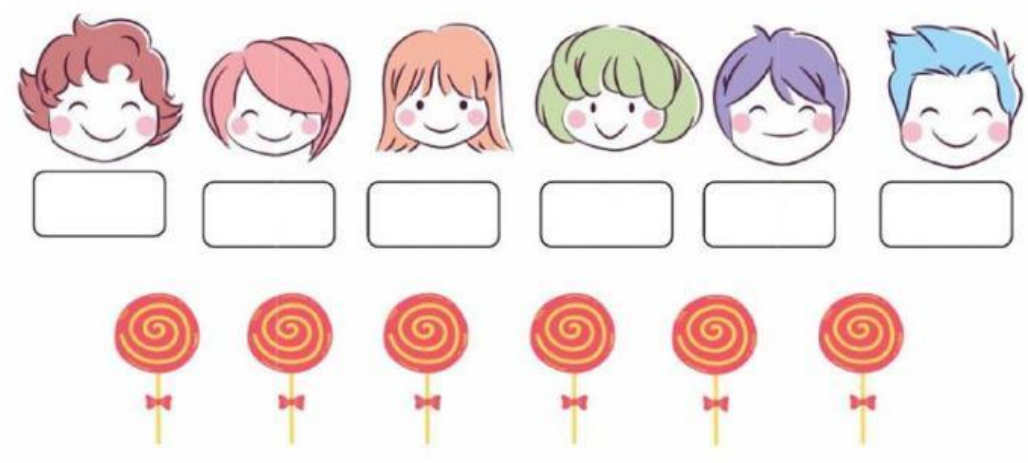

LIVEWORKSHEETS