Ordering Numbers up to 1000 Worksheet

5 8 2

1. What is the **greatest** number you can make using the three digit cards above? _____
2. What is the **smallest** number you can make using the three digit cards above? _____

3. Use the >, < and = symbols to complete the statements below.



4. Place the numbers below in the correct order on the number line.

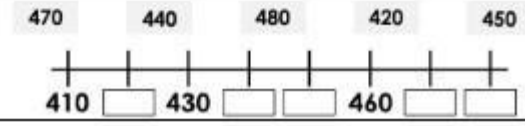

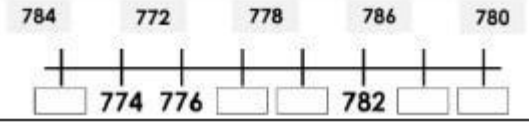

5. Place the numbers below in **ascending** order.

410 90 820 170 960 — ____, ____, ____, ____, ____

320 660 280 630 150 — ____, ____, ____, ____, ____

423 342 234 432 324 — ____, ____, ____, ____, ____

6. Place the numbers below in **descending** order.

410 90 820 170 960 — ____, ____, ____, ____, ____

320 660 280 630 150 — ____, ____, ____, ____, ____

423 342 234 432 324 — ____, ____, ____, ____, ____

7. The numbers below have been placed in **ascending** order. True or false? Explain your answer.

210 340 290 360 380

8. The numbers below have been placed in **ascending** order.
Jodie says... The missing number could be **930**
Is she correct? Explain your answer.

890 910 [illegible]

LIVEWORKSHEETS