Name:_____

Time by the Hour

Directions: Write the time for each clock.

:00	 :00
:00	:00
:00	:00
:00	 :00
 :00	:00

LIVEWORKSHEETS