Name: _____ Date: _____

# Telling Time

Write the time for each clock.

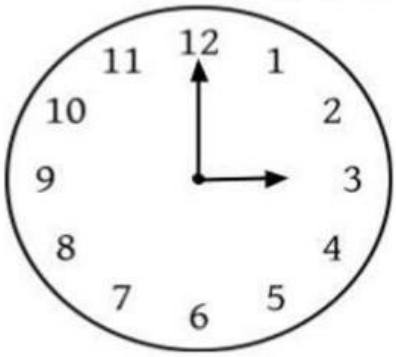

___ o'clock



___ o'clock



___ o'clock



___ o'clock



___ o'clock



___ o'clock



___ o'clock

___ o'clock

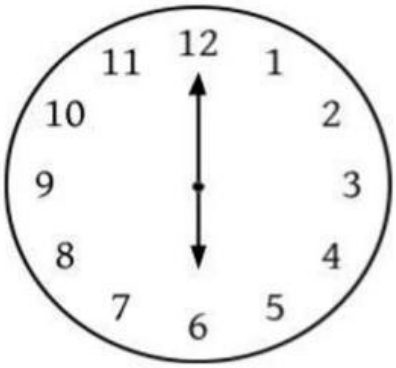

___ o'clock

www.worksheetdigital.com

LIVEWORKSHEETS