mathskills4kids

Name: ..... Class: .....

Addition with cubes: Up to 10

In each case, add and write the correct number of objects.

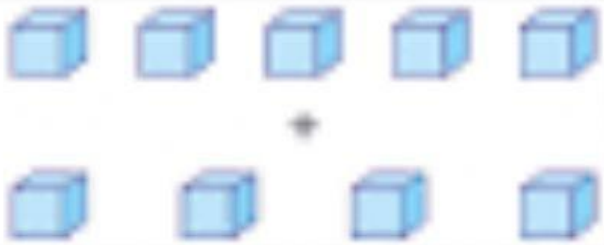	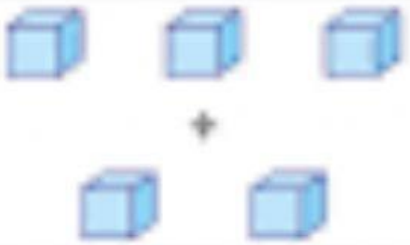
5 + 4 = ...	3 + 2 = ...

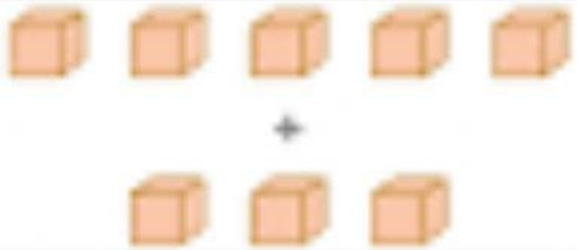	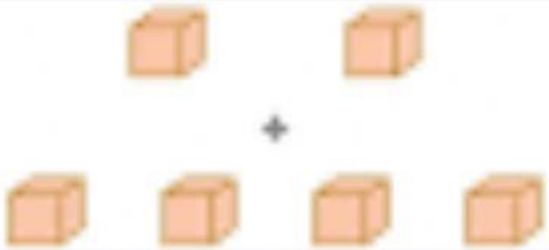
5 + 3 = ...	2 + 4 = ...

6 + 4 = ...	4 + 4 = ...

© www.mathskills4kids.com