LESSON 3:

EQUIVALENT LENGTHS

1a. Complete the measurement to match the length shown on the ruler.

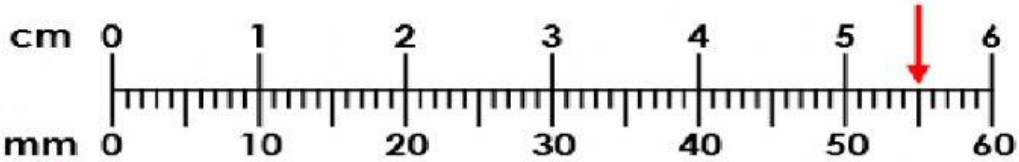

D _____cm 5 mm

VF

4b. Tick the insect that is the same length as the worm below.

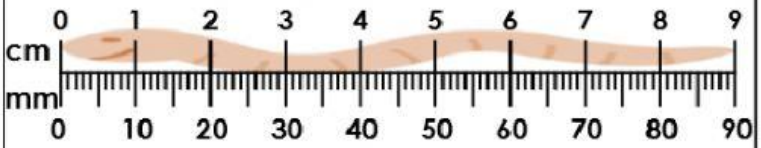

Not to scale

A. 7cm 5mm ☐

B. 9cm ☐

D C. 19cm ☐

VF

1b. Complete the part-whole model below.

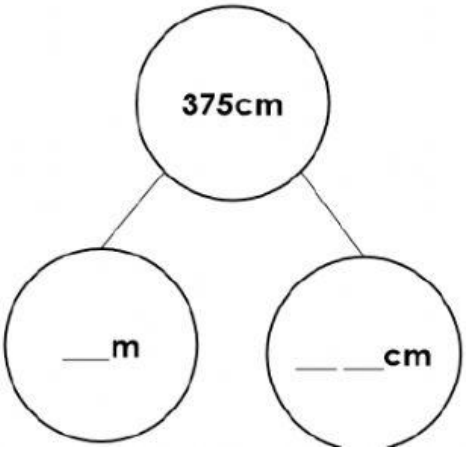

LIVEWORKSHEETS

8a. Complete the conversion table:

m and cm ⟷	cm
6m and 48cm	cm
	416cm
9m and 64cm	cm
	589cm
0m and 98cm	cm

7a. Put these lengths in order from shortest to longest.

3m and 29cm	239cm	2m and 97cm
2m and 93cm	392cm	279cm

LIVEWORKSHEETS