Mathematics

Ninety Family Numbers ED

A. Type the ninety family numbers

B. How many tens and ones?

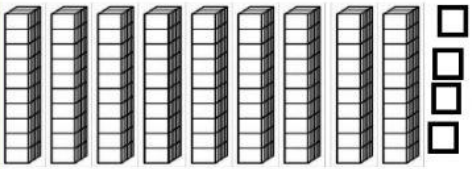

_____tens_____ones =_____

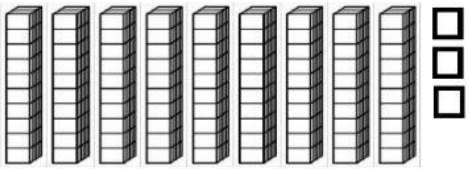

_____tens _____ones =_____

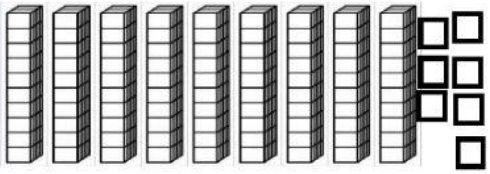

_____tens _____ones =_____

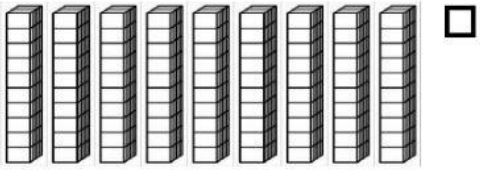

_____tens _____ones =_____

C. Fill in the missing number (before, after, between)

D. _____, 91 E. _____, 99 F. _____, 95

G. 98, _____ H. 90, _____ I. 97, _____

J. 94, _____, 96 K. 97, _____, 99 L. 95, _____, 97

Click the greatest (biggest) number in each set.

(M) 98 91 (N) 90 95 (O) 97 96

P. Which number doesn't belong?

99 90 98 91 97 63

LIVEWORKSHEETS