الإمارات العربية المتحدة
وزارة التربية والتعليم

Name of the student: _____

Grade : 3- Date: _____

Count the number of sides and identify the name of the polyron

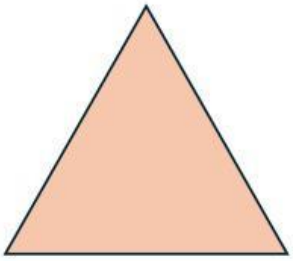			
No. of sides	Name of the polygon	No. of sides	Name of the polygon
			
No. of sides	Name of the polygon	No. of sides	Name of the polygon
			
No. of sides	Name of the polygon	No. of sides	Name of the polygon

LIVEWORKSHEETS