Addition and subtraction Extension 2

Find the difference between A and B.

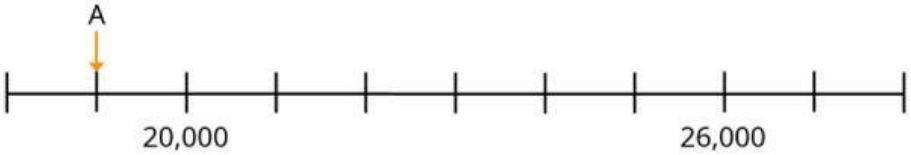

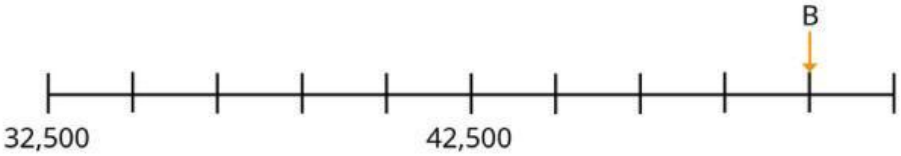

A =

Difference =

B =

1. Zeebob the alien wants to visit three different planets. The journeys he can make, and the distance between the planets in light-years, are shown on his map below.

Zeebob travels from his home planet and arrives on Planet X.
He then visits two more planets. Altogether, he has travelled a total of 957,487 light-years.

Investigate how many light-years there might be between Zeebob's home planet and Planet X.

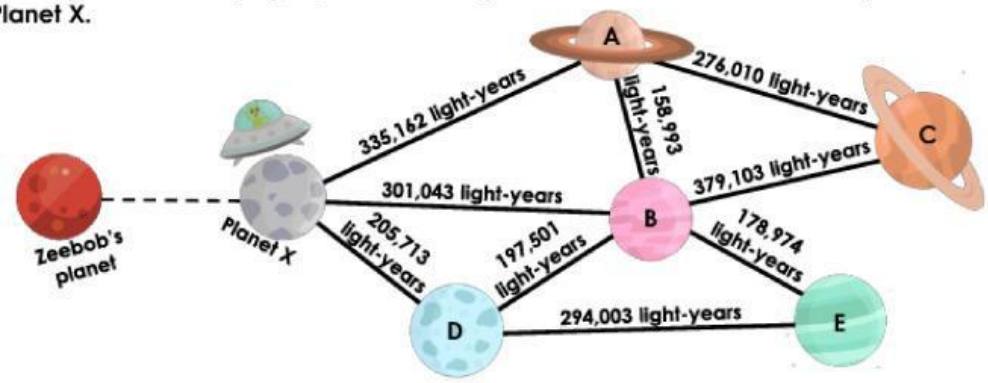

Explain your findings

LIVEWORKSHEETS