GREENFIELD SCHOOL

Happy School - an education from the heart within

CAMBRIDGE International Education

Cambridge International School

Cambridge Primary Mathematics 4

Unit 1.2 – More on negative numbers

1. Here are some temperatures.

4 °C −3 °C 5 °C 0 °C −2 °C

a Which is the warmest temperature? _____

b Which is the coldest temperature? _____

2. Circle the **larger** number in each pair.
Find the difference between the two numbers.
Use the number line to help you.

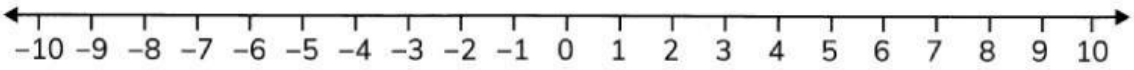

a −6 −2 Difference: _____

b −3 −1 Difference: _____

c 4 −4 Difference: _____

LIVEWORKSHEETS

3. Look at the number line.

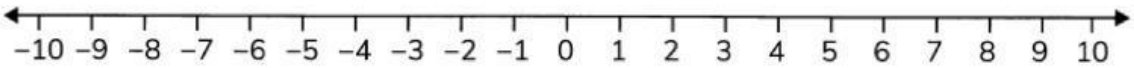

Write where you would land on the number line after these moves.

	start	count on	end		start	count back	end
a	−4	1	_____	**b**	6	6	_____
	start	count on	end		start	count back	end
c	−5	3	_____	**d**	0	9	_____

4. The temperature outside when Soraya arrived at school was −1 °C.
By lunchtime the temperature had risen by 8 °C.
What was the temperature at lunch time?

_____

5. Put these numbers in order on the number line.

−1 1 −2 −3 −5

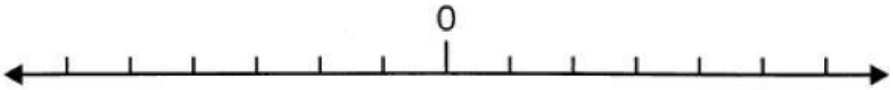

LIVEWORKSHEETS

6. Write the missing numbers in these sequences.

a −12, −8, _____, 0, 4, 8, _____

b −15, _____, −5, 0, 5, _____, _____

7. Here is part of a number line.
Write the missing numbers in the boxes.

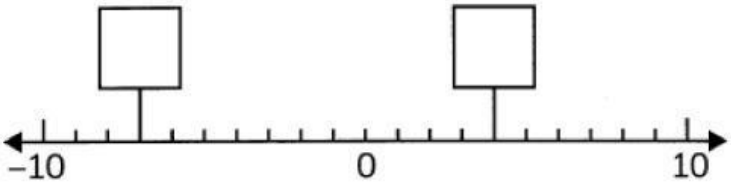

LIVEWORKSHEETS