› 1.2 Counting up to 100 objects

Exercise 1.2

Focus

accurate, accurately
collection order

1 Write the missing numbers.

1 ten →	10
2 tens →	
3 tens →	
4 tens →	
5 tens →	
6 tens →	
7 tens →	
8 tens →	
9 tens →	
10 tens →	

LIVEWORKSHEETS

2 Which tens number is 1 ten more than 8 tens?

3 Which tens number is 1 ten fewer than 6 tens?

4 Sofia and Zara make some numbers. Sofia chooses the tens. Zara chooses the ones.

Write each number they make in a part whole diagram.

a

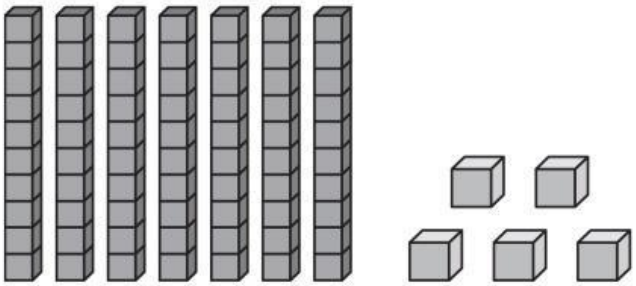

b



c Sofia chooses four tens.
Zara chooses zero ones.

LIVEWORKSHEETS

Worked example 2

Arun scoops some stones out of a tray.

How many stones does he scoop out?

Estimate then count.

More than 10, but fewer than 50. I estimate 20.



Estimate			
10	(20)	50	100
Count			

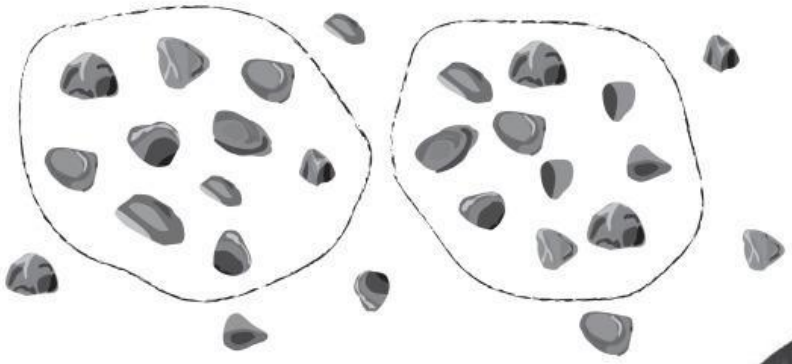

Count in tens: 10, 20. Count on in ones: 21, 22, 23, 24, 25, 26, 27.

Answer: 27 stones

LIVEWORKSHEETS

5 How many cubes are in the collection?

Estimate then count to check.

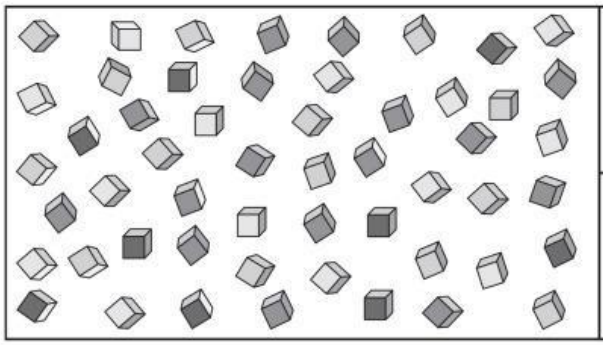

Estimate			
10	20	50	100
Count			

Compare your estimate and count with another person's.
Do you both agree?

6 Sofia counts 100 beads in twos.

Draw a ring around any numbers she said.

24 59 36 42 17 78 12

Practice

7 Write the tens numbers in order, from 100 to 10.

100									10

8 Marcus and Arun make some numbers.
Marcus chooses the tens. Arun chooses the ones.

They make 53 and 87.

How many tens does Marcus choose? ☐ and ☐

How many ones does Arun choose? ☐ and ☐

LIVEWORKSHEETS