NOME:

DATA: TURMA:

CONTANDO OS ELEMENTOS

MARQUE A OPÇÃO QUE REPRESENTA A QUANTIDADE DE CADA CONJUNTO



1 2 3

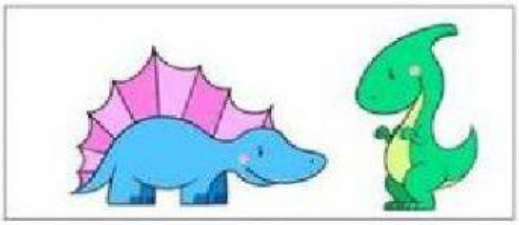

1 2 3



1 2 3



1 2 3

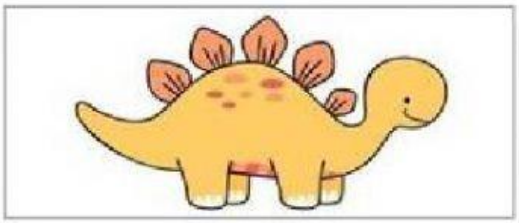

1 2 3

Prof. Suzana e Prof. Valéria

LIVEWORKSHEETS