Vardas..... Data.....

1. Remdamasis lentelėje pateikta informacija apskaičiuok, kiek kiekvienos rūšies jogurtų suvalgė vaikai.

Jogurto rūšis	Vanilinis	Bananinis	Braškinis	Avietinis
Jogurtų skaičius	40	32	27	42
Suvalgytų jogurtų dalis	$\frac{1}{8}$	$\frac{1}{4}$	$\frac{1}{9}$	$\frac{1}{6}$
Suvalgytų jogurtų skaičius				

3. Parašyk, kokias trupmenas dengia lapeliai.

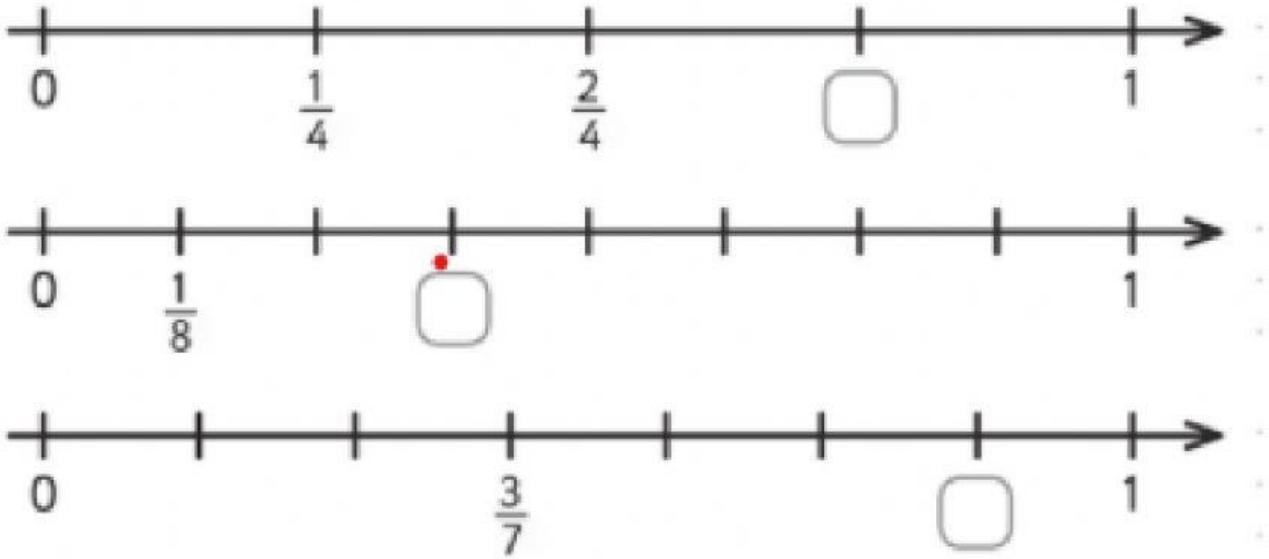

LIVEWORKSHEETS

1. Kiekvienoje schemoje nurodyta, kam lygi viena skaičiaus dalis. Rask visą skaičių.

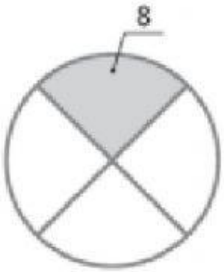

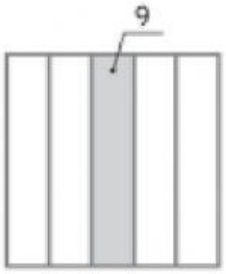



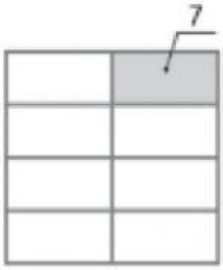

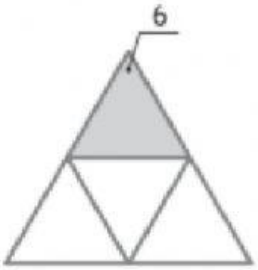

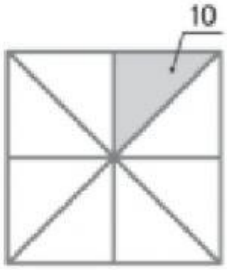

2. Silvija jau sunaudojo 3 gabalėlius modelino. Tai sudaro $\frac{1}{8}$ visų Silvijos turimų modelino gabalėlių. Kiek gabalėlių modelino turėjo Silvija?

3. Kiek spalvotų pieštukų yra dėžutėje, jei $\frac{1}{4}$ šių pieštukų, arba 7 pieštukus, Mantas padrožė?

LIVEWORKSHEETS

1. Indelis jogurto kainuoja 2 Eur. Tai sudaro $\frac{1}{3}$ sūrio kainos. Kiek eurų kainuoja sūris?

2. Nuspalvink nurodytą figūrų dalį. Trupmenas palygink.

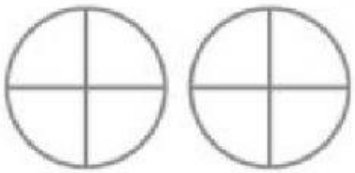

$\frac{1}{4} \square \frac{2}{4}$

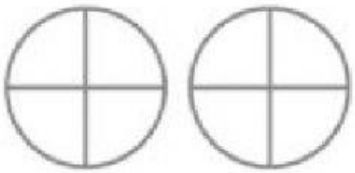

$\frac{2}{4} \square \frac{3}{4}$

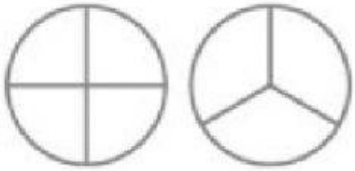

$\frac{2}{4} \square \frac{2}{3}$

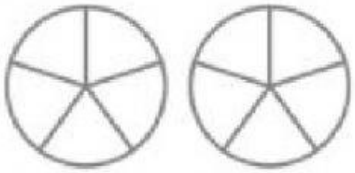

$\frac{2}{5} \square \frac{3}{5}$

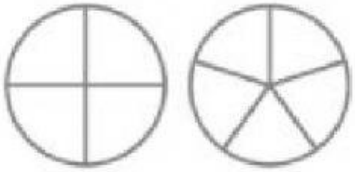

$\frac{1}{4} \square \frac{1}{5}$

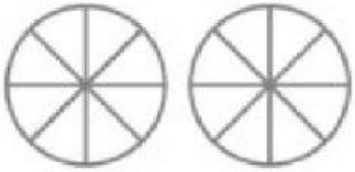

$\frac{5}{8} \square \frac{3}{8}$

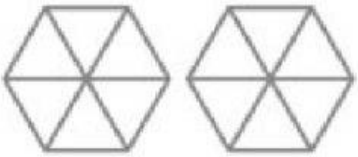

$\frac{4}{6} \square \frac{1}{6}$

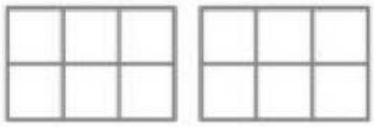

$\frac{1}{6} \square \frac{5}{6}$

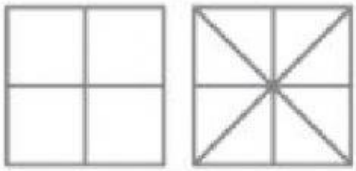

$\frac{1}{4} \square \frac{1}{8}$

LIVEWORKSHEETS