Name: _____ Date: | | | -- | | | -- | | |

Instructions:
1. Read the pictograph.
2. Answer the questions in the boxes below.

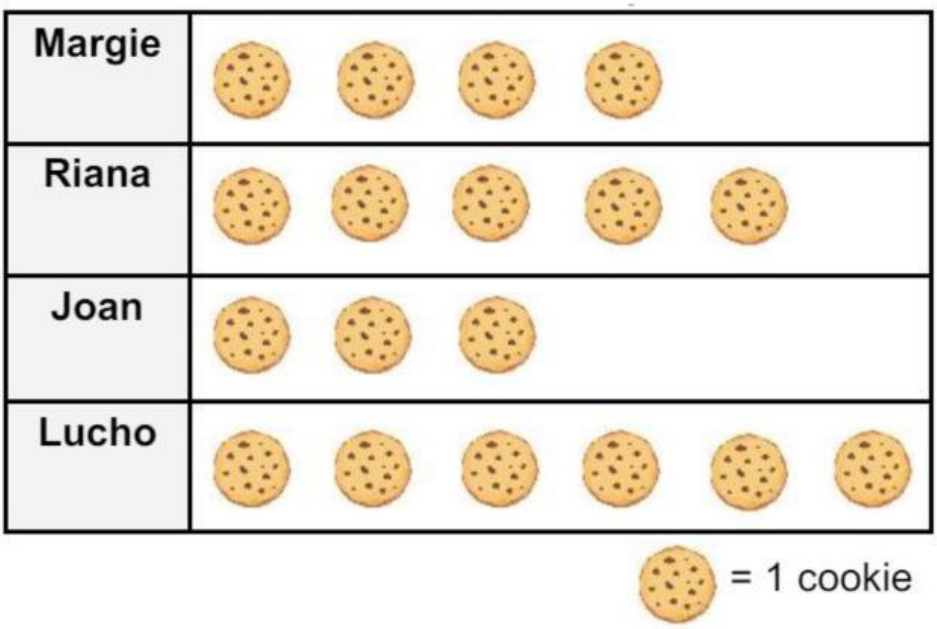

1. Who has the <u>most</u> cookies?	

2. How many cookies does **Riana** and **Margie** have <u>altogether</u>?	5 + 4 =

3. How many cookies does **Lucho** have <u>compared to</u> **Joan**?	6 - 3 =

4. How many cookies does **Riana** and **Lucho** have <u>in total</u>?	+ =

LIVEWORKSHEETS

Instructions:
Look at the pictograph and answer the questions in the boxes below.

Numbers of votes

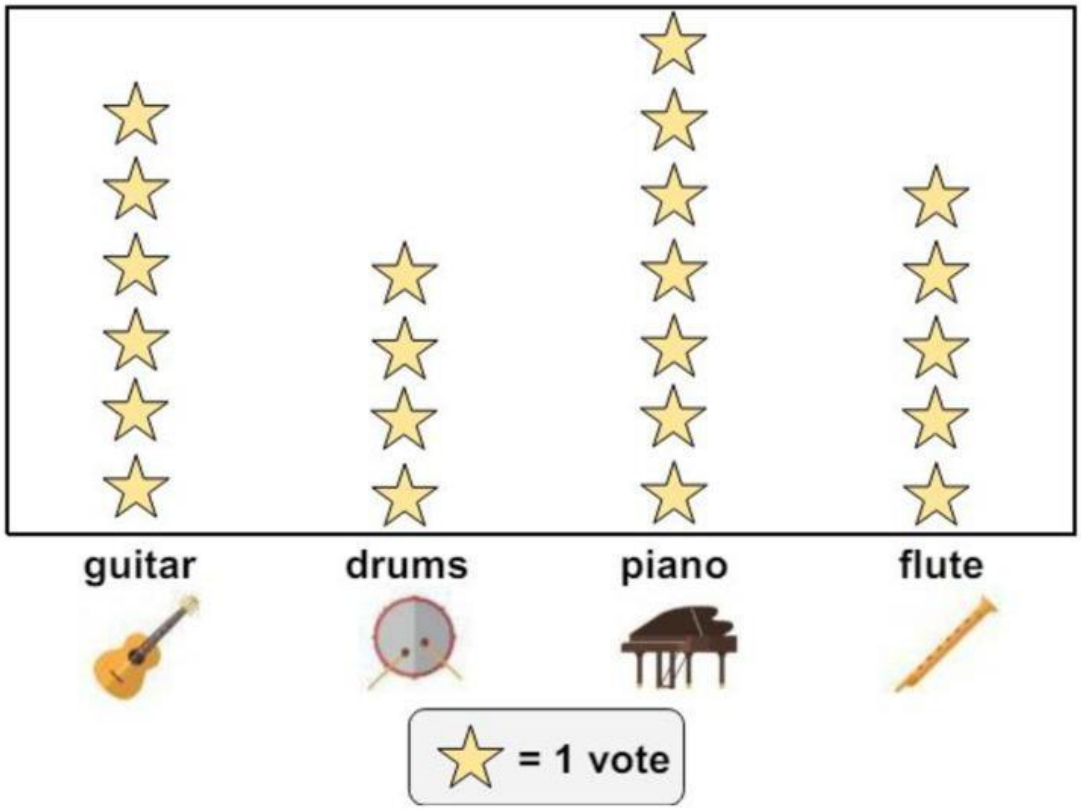

1. Which instrument has the <u>most</u> votes?	

2. How many <u>more</u> votes does **Piano** have <u>than</u> **Drums**?	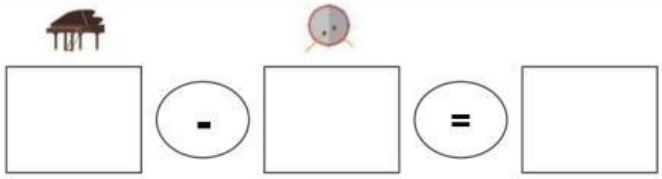

3. How many votes are there for **Flute** and **Guitar** <u>altogether</u>?	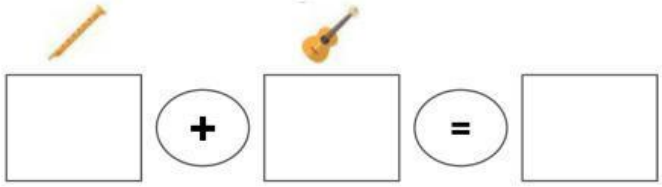

4. Which instrument has the <u>least</u> vote?	

LIVEWORKSHEETS

Instructions:
Look at the pictograph and answer the questions in the boxes below.



1. How many votes are there <u>altogether</u> for **Pizza** and **Hot Dog**?	☐ + ☐ = ☐
2. Which food has the <u>least</u> vote?	
3. How many more votes does **Chicken nuggets** have <u>compared to</u> **Hamburger**?	☐ - ☐ = ☐
4. How many more votes does **Pizza** have <u>compared to</u> **Hotdog**?	☐ - ☐ = ☐

LIVEWORKSHEETS

Instructions:
Look at the pictograph and answer the questions in the boxes below.

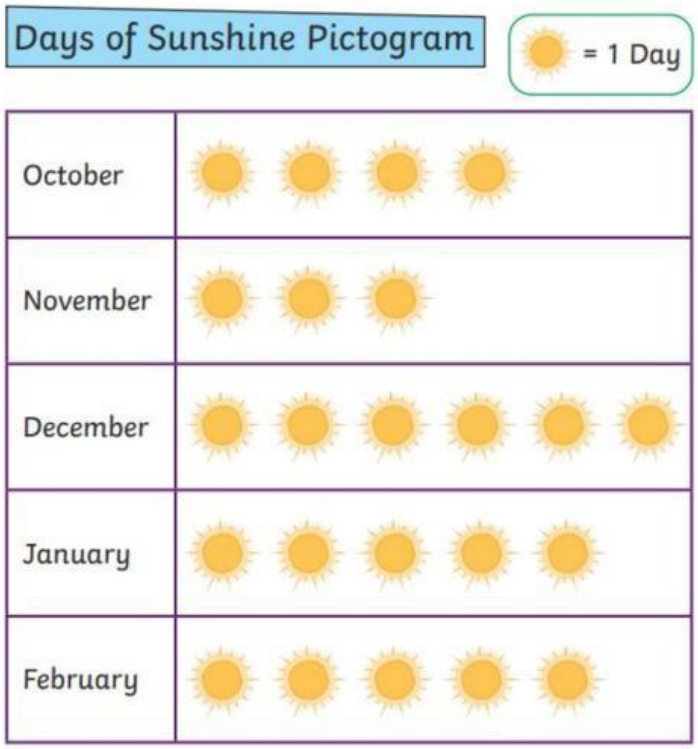

1. How many days of sunshine does each month have?	
January	
February	
October	
November	
December	

2. Which month had the <u>most</u> sunny days?	

3. Which month had the <u>least</u> sunny days?	

4. How many <u>more</u> days of sunshine are there in **December** <u>than</u> **November**?	**6** - **3** =

5. How many days of sunshine are there <u>altogether</u> in **October** and **January**?	**4** + **5** =

LIVEWORKSHEETS