Vernier Caliper

OnlineTuition.com.m

Exercise 1

Find the readings of the vernier calipers below.

1. 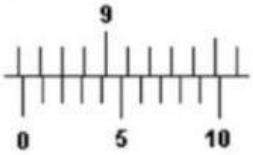	2. 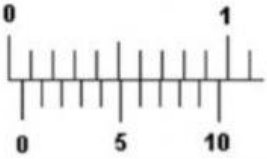	3. 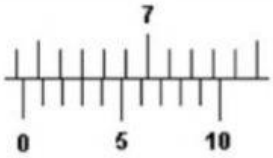
8.6 cm + 0.02cm = 8.62cm		
4. 	5. 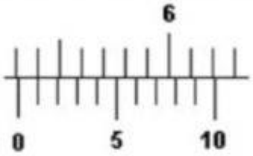	6. 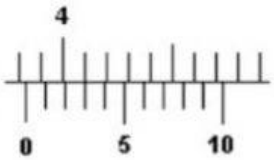
7. 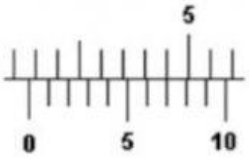	8. 	9. 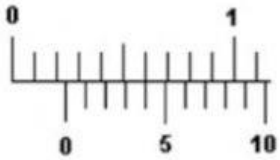

LIVEWORKSHEETS