Họ và tên: _____ Lớp: _____

# SINH SẢN Ở VI SINH VẬT

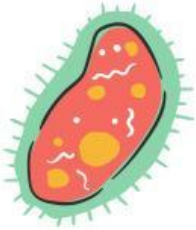

Ghép tên các hình thức sinh sản ở VSV vào dưới các hình ảnh tương ứng

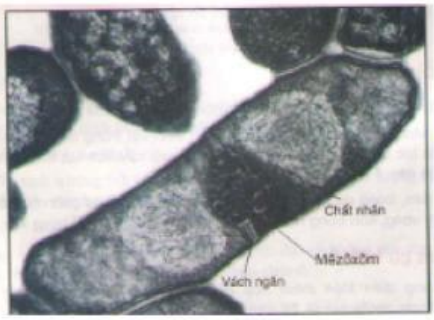


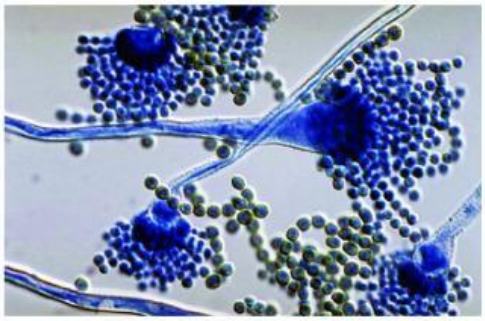




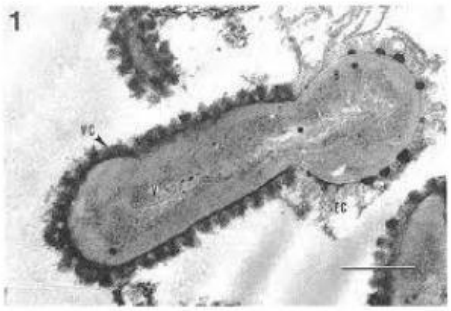


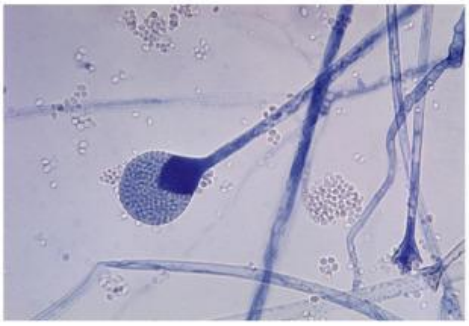

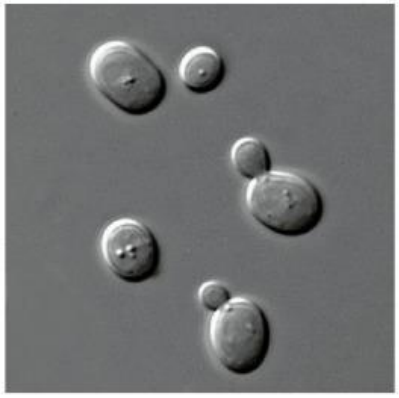

Bào tử kín | Bào tử trần | Phân đôi

Bào tử đốt | Nảy chồi | Ngoại bào tử

LIVEWORKSHEETS