GHÉP NỐI

Lựa chọn tỉ số lượng giác phù hợp để tính đoạn thẳng chưa biết trong hình vẽ dưới đây:

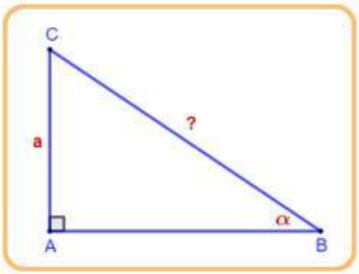

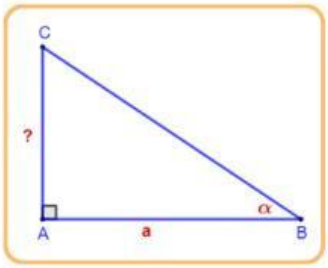

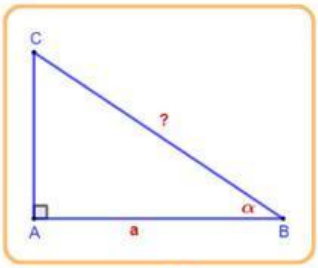

- $\cos\alpha$
- $\sin\alpha$
- $\tan\alpha$

LIVEWORKSHEETS