Describe the Groups

To describe equal groups.

Complete the sentences to describe the groups.



There are _____ equal groups.

There are _____ stars in each group.



There are _____ equal groups.

There are _____ stars in each group.



There are _____ groups of _____.



There are _____ groups of _____.



There are _____ groups of _____.



There are _____ groups of _____.

LIVEWORKSHEETS

Repeated Addition Expressions

To describe groups with repeated addition expressions.

Complete the bar models and repeated addition expressions for these representations.



2	2	2

2 + _____ + _____



4	

_____ + _____

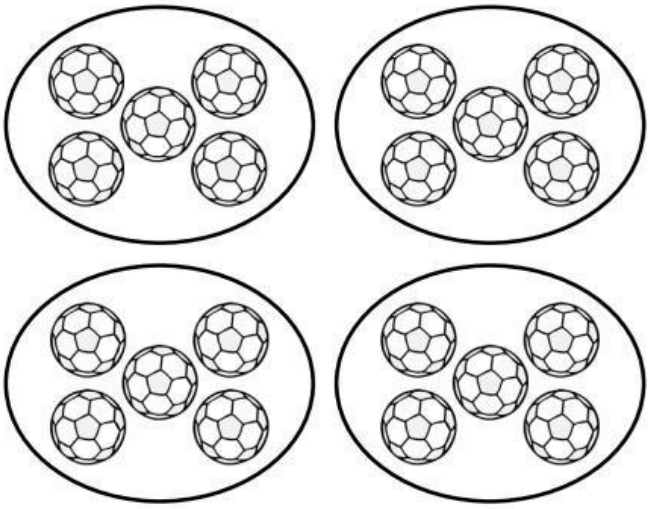

5			

_____

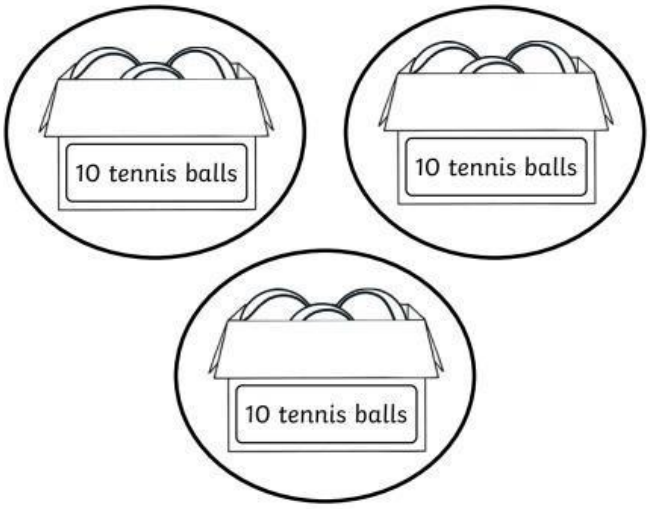

_____

LIVEWORKSHEETS

Repeated Addition Expressions

To describe groups with repeated addition expressions.

Complete the bar models and repeated addition expressions for these representations.

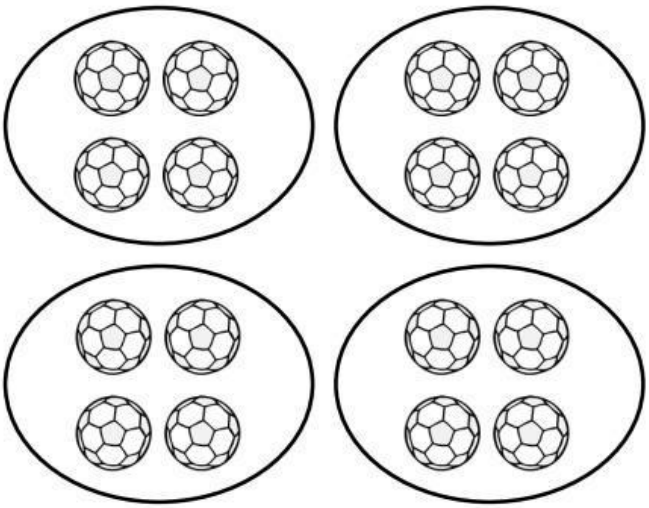

_____ + _____ + _____ + _____

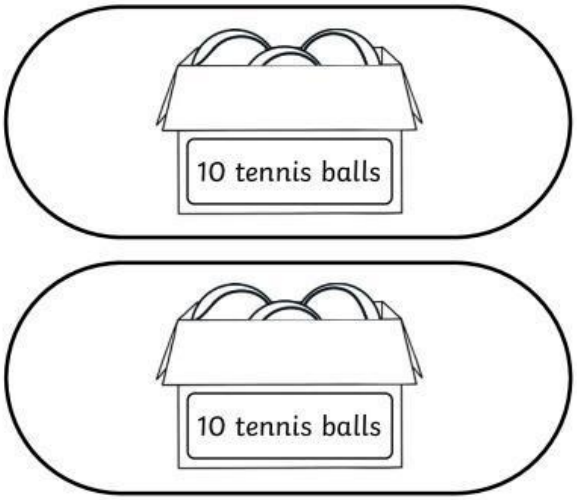

_____

Draw representations to match the bar models and repeated addition expressions. You can draw groups of any objects you choose.

5	5	5	5

5 + 5 + 5 + 5

2	2	2

2 + 2 + 2

LIVEWORKSHEETS

Multiplication Expressions

To write multiplication expressions using the 'x' symbol.

Draw a line to match the picture to the multiplication expression.



3 × 2



4 × 10

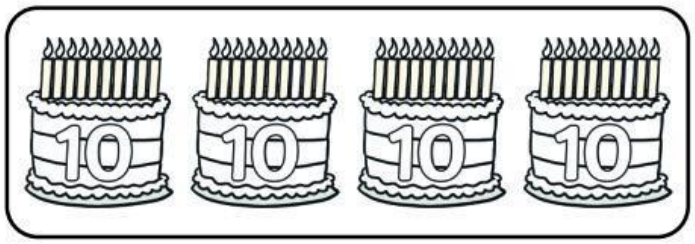

4 × 5

Write the multiplication expression to match these pictures.



_____ × _____

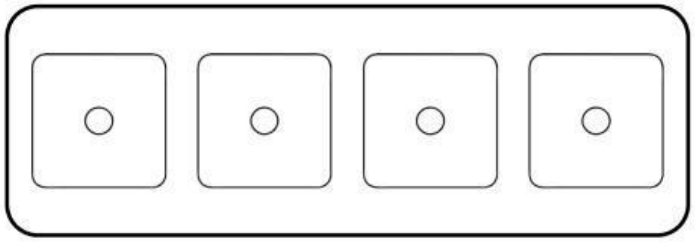



LIVEWORKSHEETS

Complete the missing expressions.

5	1 × 5
5 + 5	2 × 5
5 + 5 + 5	_____ × 5
5 + 5 + 5 + 5	
5 + 5 + 5 + 5 + 5	
5 + 5 + 5 + 5 + 5 + 5	

Represent these multiplication expressions with counters.
Draw the groups you have made.

5 × 2

3 × 5

2 × 10

6 × 1

LIVEWORKSHEETS

Multiplication Expressions

To write multiplication expressions using the 'x' symbol.

Write the multiplication expressions to match these pictures.



_____ × _____



_____ × _____

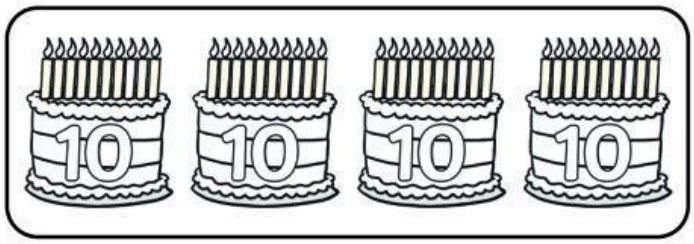

_____ × _____

Write the multiplication expression to match these bar models.

1	1	1	1

_____ × _____

10	10	10

0	0	0	0	0

5	5

2	2	2	2	2	2

LIVEWORKSHEETS

Complete the missing expressions.

5	1 × 5
5 + 5	
	3 × 5
5 + 5 + 5 + 5	
	5 × 5
5 + 5 + 5 + 5 + 5 + 5	

Write a multiplication expression to match the statements.

I have 8 times 1.

I have 7 groups of 10.

I have 2 + 2 + 2.

Represent these multiplication expressions with counters:

5 × 2 | 3 × 5 | 2 × 10 | 6 × 1

LIVEWORKSHEETS