Lembar Kerja Peserta Didik

LKPD

Pendidikan Ilmu Pengetahuan Alam
"Topik A: Cahaya dan Sifatnya"

5

LIVEWORKSHEETS

Nama Kelompok: Kelas:

Cahaya

Pasangkanlah gambar dengan sifat-sifat cahaya berikut ini.

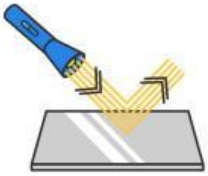

- Merambat lurus

- Bisa dipantulkan

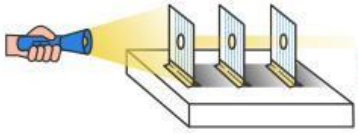

- Menembus benda bening

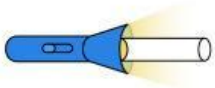

- Bisa dibiaskan

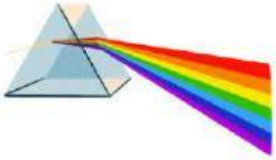

- Bisa diuraikan

LIVEWORKSHEETS

Nama Kelompok:_____ Kelas: _____

Proses Melihat

Tulislah keterangan proses yang terjadi beserta nama bagian mata di kolom kosong pada gambar skema proses melihat di bawah ini!

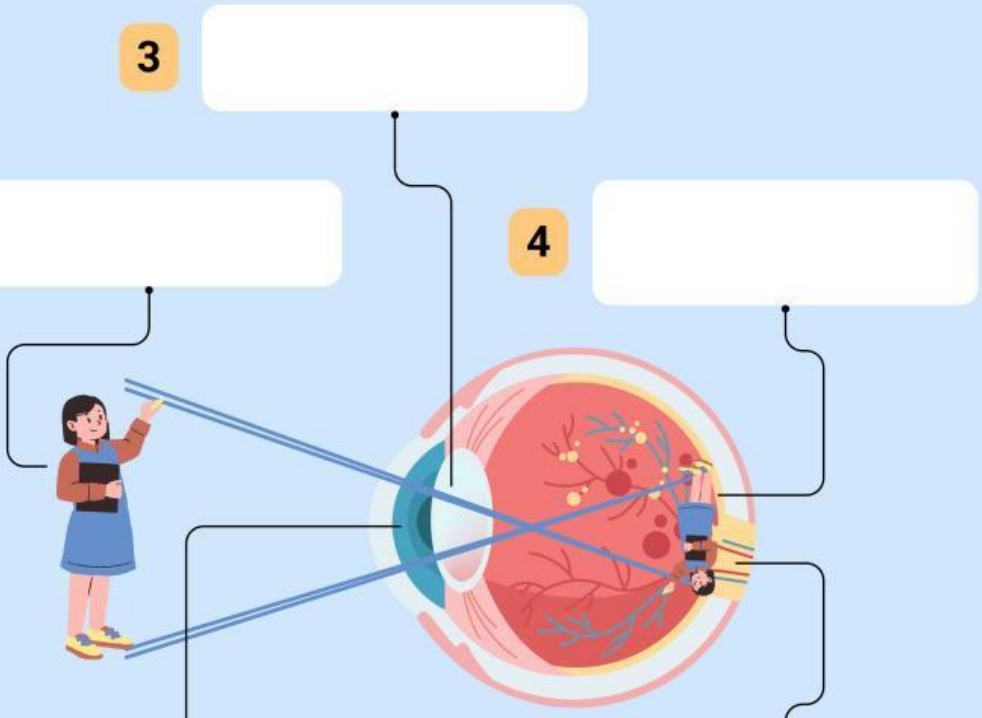

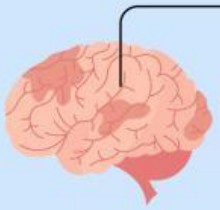

6

LIVEWORKSHEETS