Nom: ..... Data: .....

6 Quantes flors hi ha?

	$\begin{array}{r} 2 \\ \times\ 2 \\ \hline \square \end{array}$ $2 + 2 = \square$
	$\begin{array}{r} 3 \\ \times\ 2 \\ \hline \square \end{array}$ $3 + 3 = \square$
	$\begin{array}{r} 4 \\ \times\ 2 \\ \hline \square \end{array}$ $4 + 4 = \square$

Nom: ..... Data: .....

6 Quantes flors hi ha?

 $1 + 1 + 1 = \square$	$\begin{array}{r} 1 \\ \times\ 3 \\ \hline \square \end{array}$
 $2 + 2 + 2 = \square$	$\begin{array}{r} 2 \\ \times\ 3 \\ \hline \square \end{array}$
$4 + 4 + 4 = \square$	$\begin{array}{r} 4 \\ \times\ 3 \\ \hline \square \end{array}$