CLASS: V 2. Shapes and Angles DATE:

1. What measure (in degrees) should be added to the following to make each as a right angle?

i) 34°+ ____ = 90° ii) 16°+ ____ = 90° iii) 19°+ ____ = 90°

iv) 28°+ ____ = 90° v) 78°+ ____ = 90° vi) 38°+ ____ = 90°

2. Measure the following angles:-

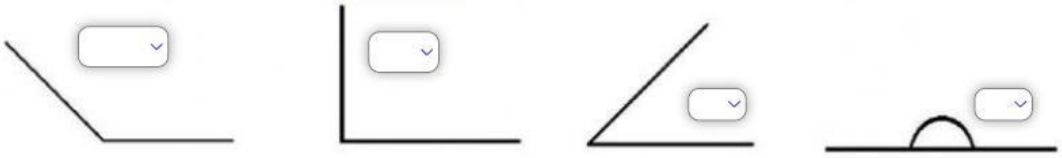

3. What kind of angle (acute , obtuse , right) is made by the hands of these clocks. Also write the time?

Angle ____ Angle ____ Angle ____

Time ____ Time ____ Time ____

4. Identify the following angles as acute, obtuse or right angles:-

a) 3 degrees -

b) 12 degrees -

c) 72 degrees -

d) 165 degrees -

e) 90 degrees -

f) 60 degrees -

5. Count the number of angles and write them in the space given.

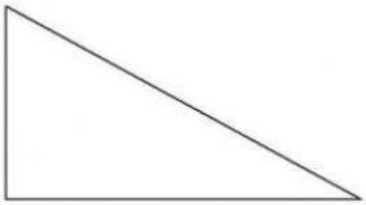





LIVEWORKSHEETS