In the opposite figure :

CA = CB , m (∠ B) = $x°$

, m (∠ ACD) = 100° where C ∈ $\overline{BD}$

, then x = ...

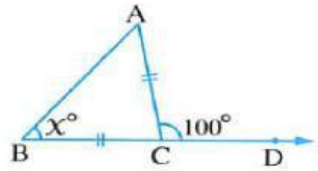

(a) 50° (b) 100° (c) 150° (d) 200°

Choose the correct answer :

1 **In the opposite figure :**

AC = ... cm.

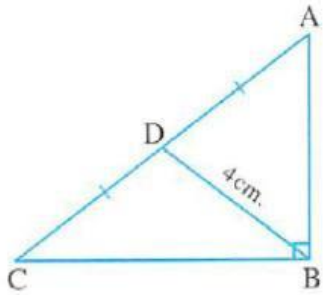

(a) 4 (b) 6

(c) 8 (d) 2

In the opposite figure :

AD = DC , m (∠ C) = 30°

, m (∠ ABC) = 90° , AB = 5 cm.

, then the perimeter of Δ ABD = ... cm.

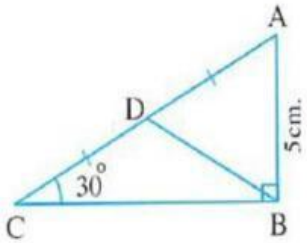

(a) 5 (b) 15 (c) 20 (d) 25

6 **In the opposite figure :**

y = ...

(a) 30°

(b) 40°

(c) 60°

(d) 70°

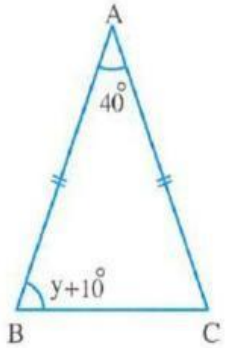

LIVEWORKSHEETS