แบบฝึกหัดที่ 2

คำชี้แจง : ให้นักเรียนเลือกรูปที่เป็นทรงกระบอก

1

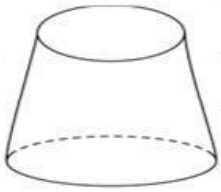

2

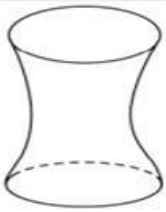

3

4

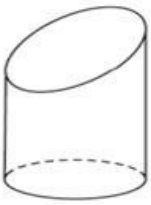

5

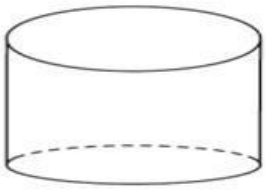

6

LIVEWORKSHEETS