GUÍA MATEMÁTICAS

SUMAS ITERADAS – MULTIPLICACIÓN

NOMBRE: _____ CURSO: 3° A-B-C-D

Objetivo: Resuelven multiplicaciones como suma reiterada

1. Observa los siguientes elementos. Cuenta y completa cuántos hay en total.

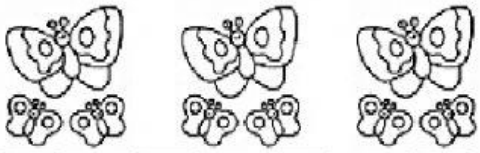

□ + □ + □ = □

□ x □ = □

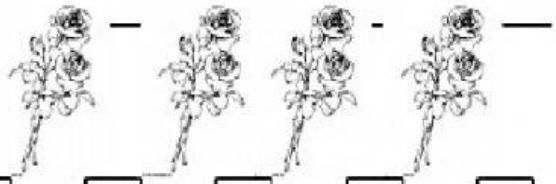

□ + □ + □ + □ = □

□ x □ = □



□ + □ + □ = □

□ x □ = □

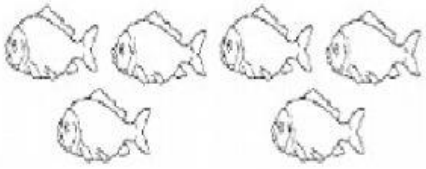

□ + □ = □

□ x □ = □



□ + □ = □

□ x □ = □

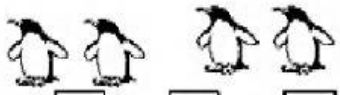

□ + □ + □ + □ = □

□ x □ = □

LIVEWORKSHEETS

Guía de Refuerzo: Iniciación a la Multiplicación

1.- Escribe en forma de suma la multiplicación:

a) ¿Cuántas almejas hay?

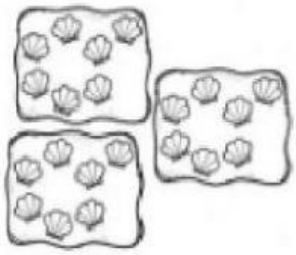

7+7+7= ☐

Multiplicación: 3 x 7 = ☐

b) ¿Cuántas abejas hay?

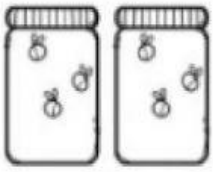

☐ + ☐ = ☐

Multiplicación: ☐ x ☐ = ☐

c) ¿Cuántos pétalos hay?

☐ + ☐ = ☐

Multiplicación: ☐ x ☐ = ☐

d) ¿Cuántos puntitos hay?



☐ + ☐ + ☐ = ☐

Multiplicación: ☐ x ☐ = ☐

LIVEWORKSHEETS