Nama : **Maria Goretibina Sembiring, Fica Miranda Br Tarigan, Adrian David Ginting**

Kelompok : **2**

Fase : **C**

Kelas : **C**

---

1. **Bangun yang memiliki 4 sisi dan keempat sisinya memiliki panjang yang sama adalah…?**

A.

C.

B.



D.

2.

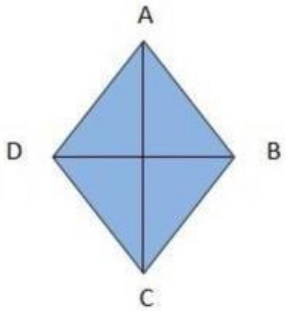

Apakah nama bangun datar di samping ini…?

A. Belah ketupat **C. Trapesium**

B. persegi **D. Jajar genjang**

3. **Yang manakah bangun datar yang memiliki sudut paling banyak…?**

A.

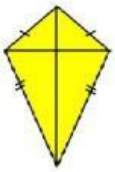

C.

B.

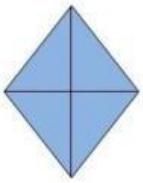

D.

LIVEWORKSHEETS