GREENFIELD SCHOOL
Happy School : an education from the heart within

Cambridge Assessment International Education
Cambridge International School

CAMBRIDGE PRIMARY MATHEMATICS 1

8.1. TIME

Name: _____ Date: _____ Class: _____

Part 1. Write the times these clocks show.

half past	o'clock

_____

_____

_____

_____

_____

_____

Part 2. Draw a ring around the correct time.

4 o'clock 5 o'clock 6 o'clock

LIVEWORKSHEETS

Part 3. Write the correct day in each empty space.

Monday Tuesday Wednesday Thursday Friday Saturday Sunday

1. 

2. 

3. 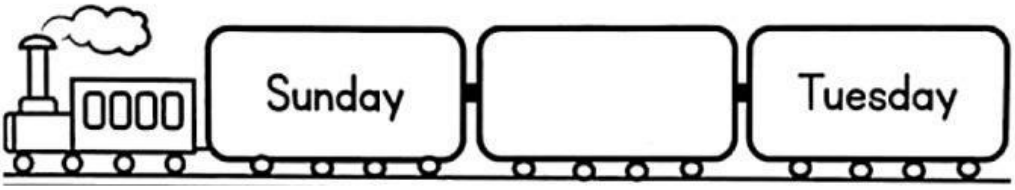

4.

5.

6. 

7. 

LIVEWORKSHEETS