Lembar Kerja peserta didik

GROUP 2

Angles

LIVEWORKSHEETS

MEMBER GROUP 2

1. Putri Anjani (2103020052)

2. Christhoper Parhusip (2103020054)

3. Welny Risesti (2103020061)

LIVEWORKSHEETS

INSTRUCTION

1. Pray before working on the E-LKPD

2. Read the instructions for using E-LKPD, and follow all instructions.

3. Work on the E-LKPD seriously with the group.

4. Fill in according to the order provided

5. Ask your teacher if you experience difficulties in working on the E-LKPD

LIVEWORKSHEETS

E-LKPD ANGGLE

Nama : _____ Tanggal : _____

Kelas : _____ Hari : _____

LIVEWORKSHEETS

Problem 1

The angle formed by the two clock hands in the picture is an angle

Answer

LIVEWORKSHEETS

PROBLEM 2

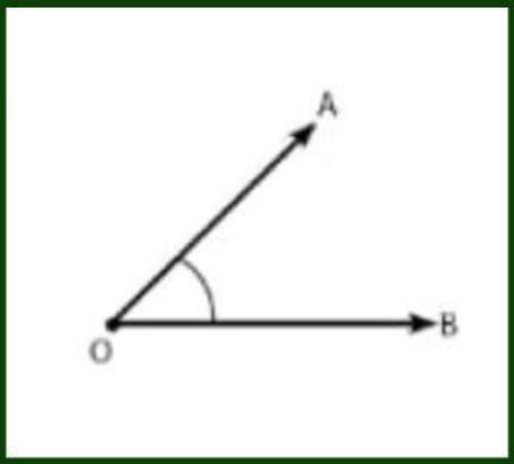

THE NAME OF THE LEG
OF THE CORNER IN THE PICTURE ON THE SIDE IS

ANSWER

LIVEWORKSHEETS

Problem 3

An angle whose measure is more than 90° but less than 180° is called an angle

Answer

LIVEWORKSHEETS

Problem 4

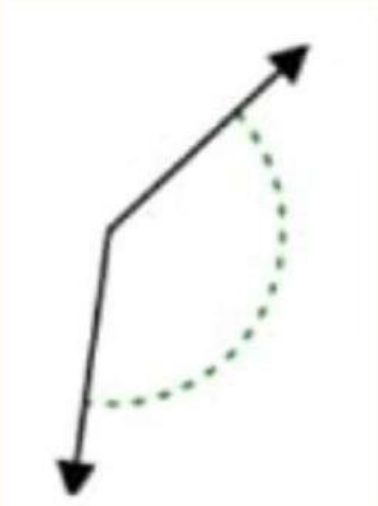

What type of angle does the figure show

Answer

LIVEWORKSHEETS

Problem 5

The corner points in the image above are points

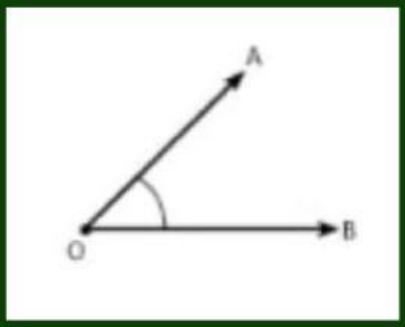

answer

.....

.....

.....

LIVEWORKSHEETS

PROBLEM 6

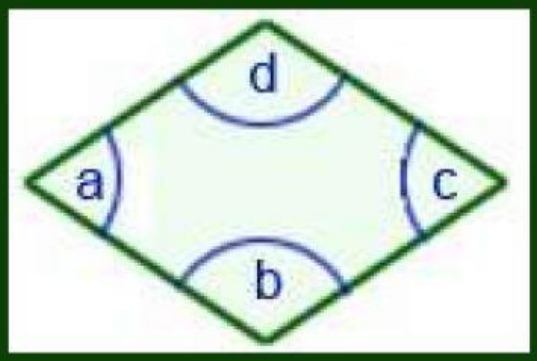

THE CORRECT STATEMENT FROM THE FOLLOWING PICTURE IS. . . .

ANSWER

LIVEWORKSHEETS

Problem 7

The hour angle formed every 1 minute shift of the long hand is . . . .

Answer

LIVEWORKSHEETS

Problem 8

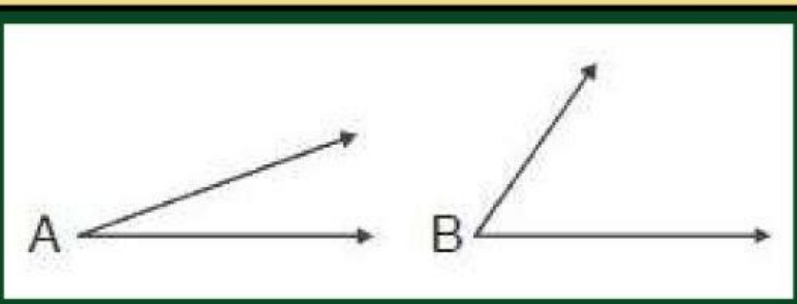

From the picture, which of the following statements is true?

Answer

LIVEWORKSHEETS

Problem 9

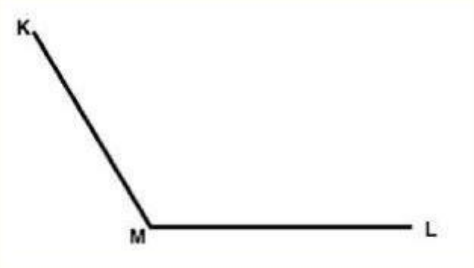

The angle formed by the intersection of the KLM lines is the angle....

Answer:

LIVEWORKSHEETS

Problem 10

The angle formed by the two hands on a wall clock is...

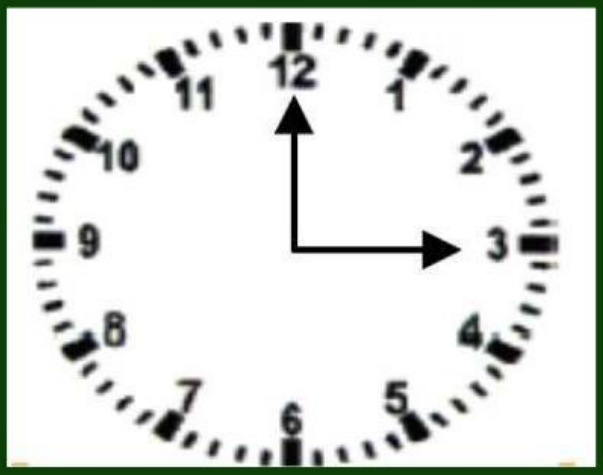

answer

.....

.....

.....

LIVEWORKSHEETS

Thank you for answering

LIVEWORKSHEETS