GREENFIELD SCHOOL
Happy School : an education from the heart within

Cambridge Assessment International Education
Cambridge International School

CAMBRIDGE PRIMARY MATHEMATICS 1

REVIEW UNIT 1

Name: _____ Date: _____ Class: _____

1. The shirts should be on the washing line in the correct order.

Draw a ring around the mistakes on the washing line.

2.

(a) Write the missing numbers.

0	1	2			5				9	

(b) Write the number that comes after.

3	

5	

(c) Write the number that comes before.

	4

	8

(d) Write the missing numbers.

	7	

		10

LIVEWORKSHEETS

3. Trace the numbers. Then match the numbers with their names.

4. Write the missing number words.

1	2 two	3	4 four	5
6 six	7	8 eight	9	10

LIVEWORKSHEETS

5. Draw a line to match the words with the correct drawings.

a pairs

3 5 9

b odd numbers

c equal

d more than



e less than

6. Compare the sets.

(a) Tick (✓) the set that has fewer insects.

LIVEWORKSHEETS

(b) Tick (✓) the set that has more insects.



(c) Tick (✓) the sets that have the same number of animals.



7. Compare the sets. Complete the sentences.



seven	more	four	fewer	the same	four

There are _____ apples, _____ oranges and _____ bananas.

There are _____ oranges than apples.

There are _____ bananas than oranges.

The number of apples and bananas is _____

LIVEWORKSHEETS

8. Count the shapes in each box and circle the correct answer.

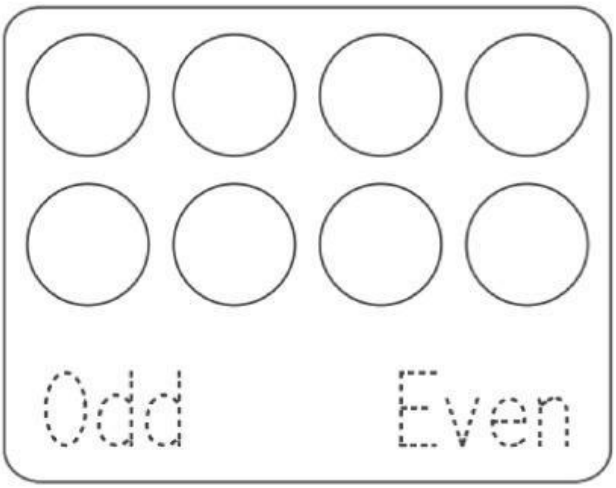



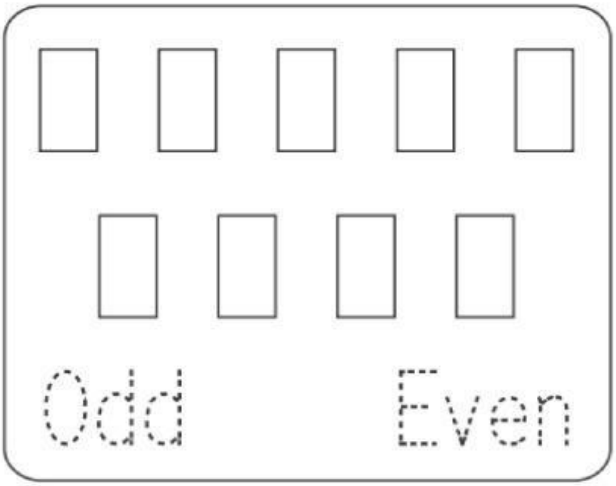

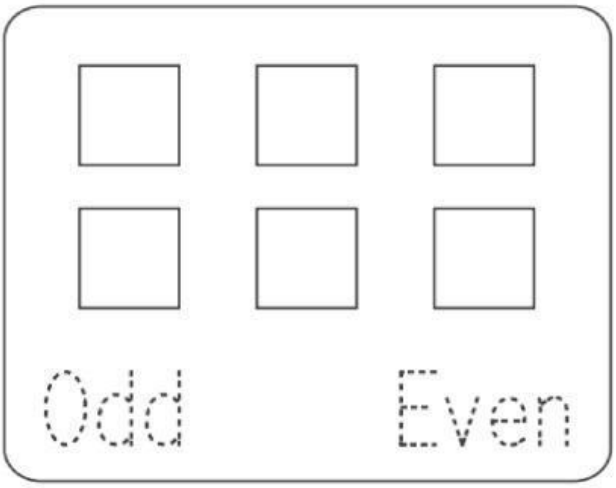

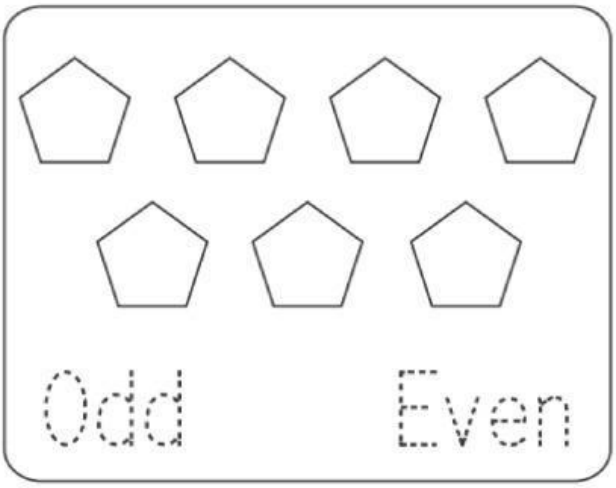

LIVEWORKSHEETS