1. Perhatikan Gambar Berikut Dan Tentukan pola barisan bangun ruang dari bentuk kubus,balok,prisma,silinder,dan kerucut!

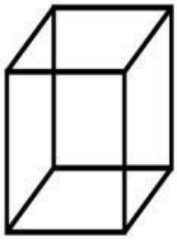
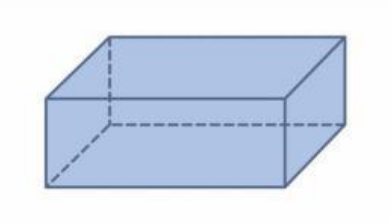
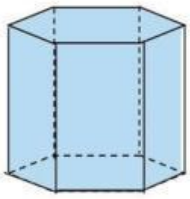


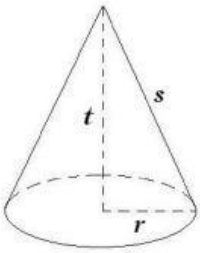

2. Perhatikan gambar berikut dan jelaskanlah pola barisan bangun datar dari bentuk persegi,persegi panjang,trapesium,belah ketupat,lingkaran!


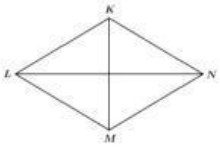

LIVEWORKSHEETS