CAMBRIDGE PRIMARY MATHEMATICS 2

REVIEW UNIT 11 (WS2)

Name: _____ **Date:** _____ **Class:** _____

Part 1. Each shape has been turned a quarter turn clockwise or anticlockwise. Write "*a quarter turn clockwise*" or "*a quarter turn anticlockwise*" under each picture.

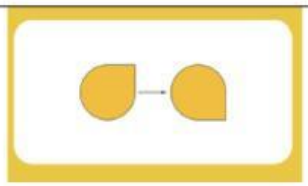	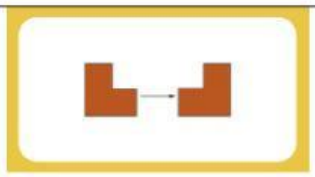	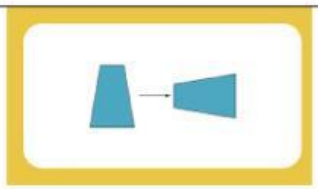
_____	_____	_____
_____	_____	_____
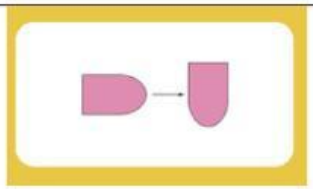	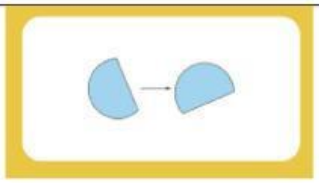	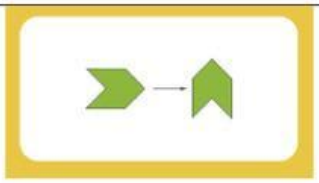
_____	_____	_____
_____	_____	_____

Quarter turn clockwise	Quarter turn anticlockwise

Part 2. Write **half turn, quarter turn, full turn** in each blank space provided:

Example:



quarter turn

half turn

full turn

_____

LIVEWORKSHEETS

....

....

Part 3. Half turn or quarter turn? Colour the correct answer. [3]

a



Half turn	Quarter turn

b

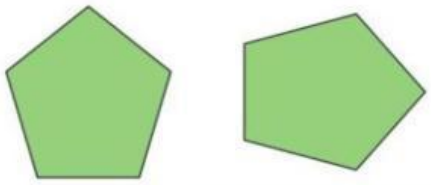

Half turn	Quarter turn

c



Half turn	Quarter turn

d



Half turn	Quarter turn

e

Half turn	Quarter turn

f



Half turn	Quarter turn

LIVEWORKSHEETS

Part 4. Which of these dots show the centre of the circle?

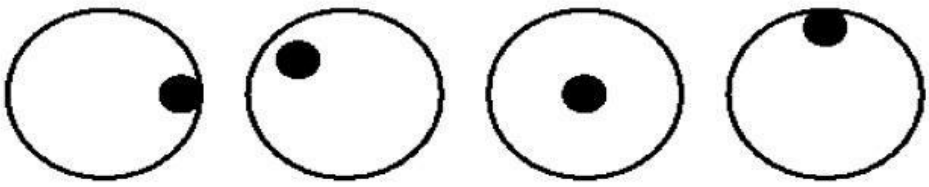

A **B** **C** **D**

LIVEWORKSHEETS