dbclassroom

Solar System 1

Read and choose

Venus	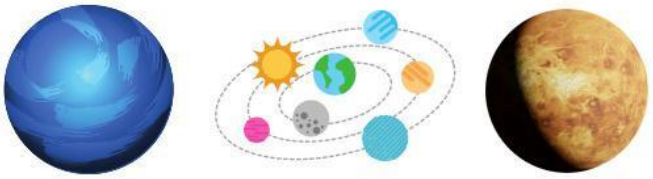
Mercury	
Sun	
Mars	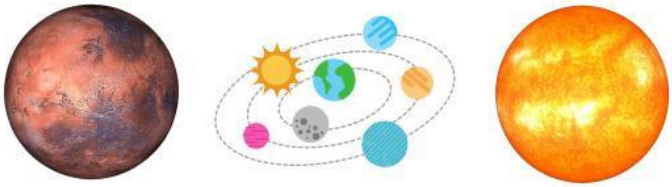
Earth	

B. MENGANALISIS STRUKTUR LAPISAN BUMI

Tempelkan nama bagian lapisan bumi dibawah yang sesuai dengan struktur lapisan bumi yang tepat

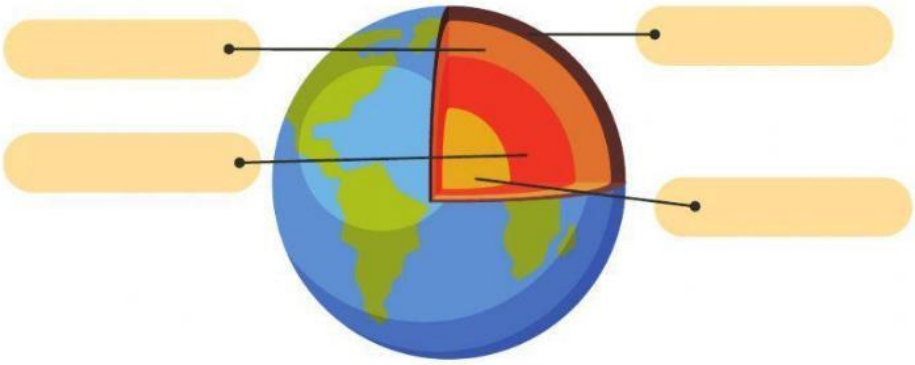

Kerak bumi | Mantel bumi | Inti luar | Inti dalam

LIVEWORKSHEETS