Nama : .....

Kelas : .....

Keliling dan LuasBangun Datar

Hitunglah keliling dan luas bangun datar di bawah, kemudian tuliskan hasilnya di kolom yang sudah disediakan.

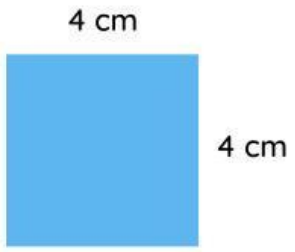

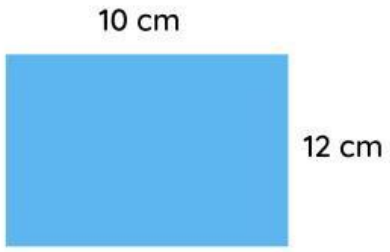

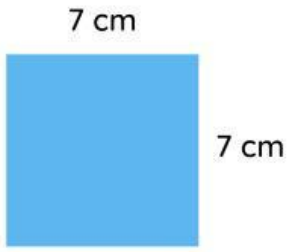

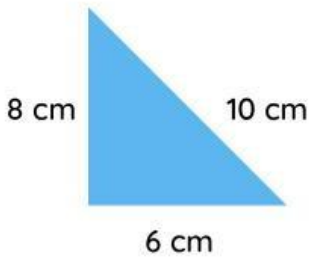

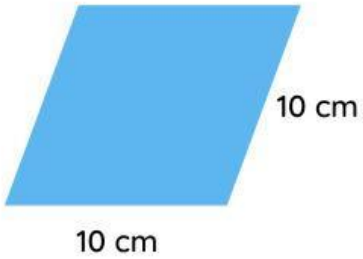

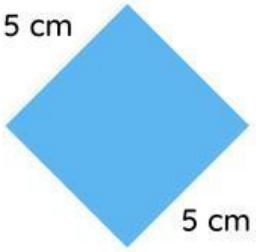

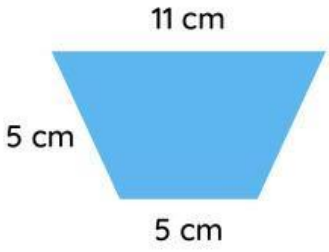

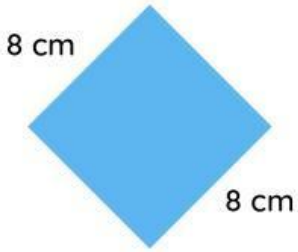

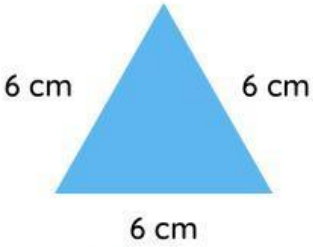

LIVEWORKSHEETS

Nama : .....

Kelas : .....

Geometri : Bangun Datar

Perhatikan gambar bangun datar dibawah ini. Tuliskan nama bangun datar, beserta jumlah sisi dan diagonalnya.

Nama .....

Jumlah sisi .....

Jumlah diagonal .....

Nama .....

Jumlah sisi .....

Jumlah diagonal .....

Nama .....

Jumlah sisi .....

Jumlah diagonal .....

Nama .....

Jumlah sisi .....

Jumlah diagonal .....

Nama .....

Jumlah sisi .....

Jumlah diagonal .....

Nama .....

Jumlah sisi .....

Jumlah diagonal .....

Nama .....

Jumlah sisi .....

Jumlah diagonal .....



Nama .....

Jumlah sisi .....

Jumlah diagonal .....

Nama .....

Jumlah sisi .....

Jumlah diagonal .....

LIVEWORKSHEETS

Name _____

PLAYGROUND PERIMETER

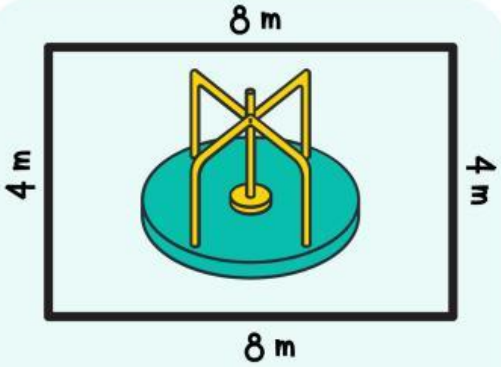

Answer _____

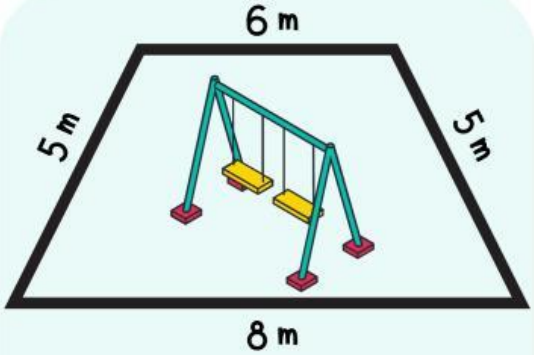

Answer _____

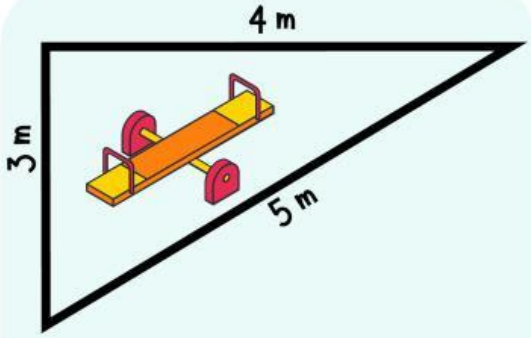

Answer _____

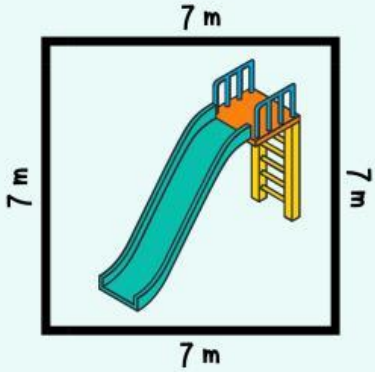

Answer _____

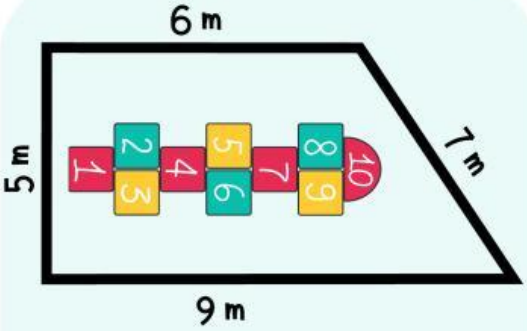

Answer _____

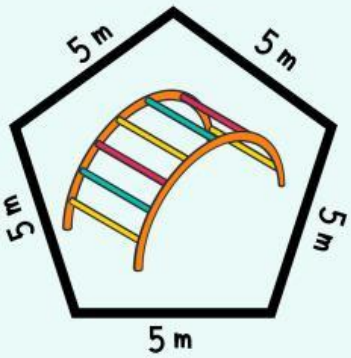

Answer _____

LIVEWORKSHEETS