TSA of Sphere: $4\pi r^2$	TSA of Rectangular Prism: 2 (lw + hw + lh)	
TSA of Cylinder: $2\pi r(r + h)$	Volume of Cube = a^3	Volume of Rectangular Prism = lwh

1. Find the TSA of Sphere: ____

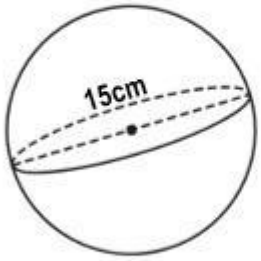

2. Find the TSA of Cylinder: ____

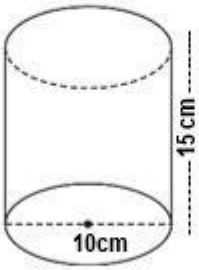

3. Find the TSA of Rectangular Prism: ____

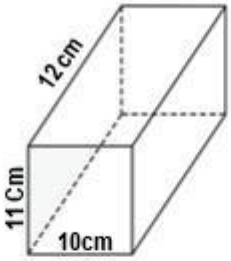

4. Find the Volume of Cube: ____

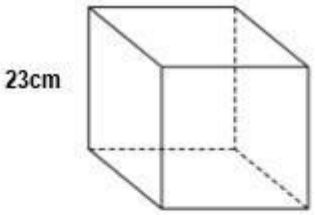

5. Find the Volume of Rectangular Prism: ____

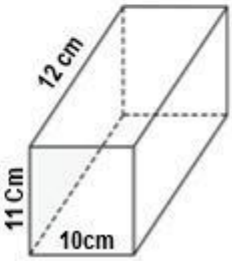

LIVEWORKSHEETS