PRIMARY MATHEMATICS LEVEL 2 – 2ND TERM FINAL TEST

Name: _____

Class: _____

I. Numbers to 100

What is the **place-holder digit** of the given number

Given number: fourty-eight 4	Given number: fifty-seven 5	Given number: eighteen 1
Given number: thirteen 1	Given number: sixty-five 6	Given number: one-hundred 1 0

Complete the row

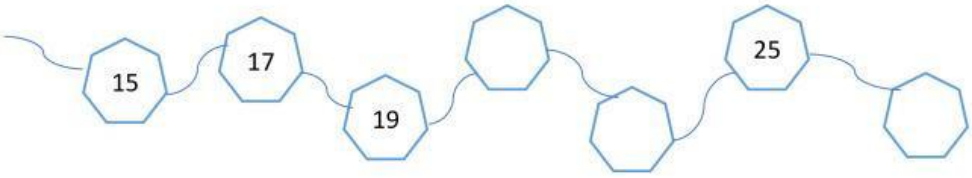

II. Counting up to 100 objects

<Let the kid counting up to 100 objects>

III. Compare and ordering numbers
https://www.liveworksheets.com/w/en/math/373172

IV. Geometry

1. 3D Shapes
Choose the correct describe about red-highlighted objects in the given picture

		

LIVEWORKSHEETS

		

2. Fractions of shape

Which picture shows **equal parts** of shape ?

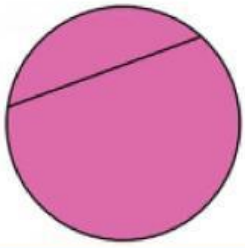	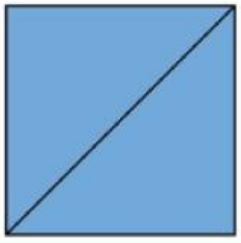	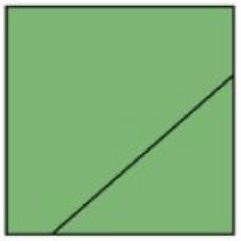
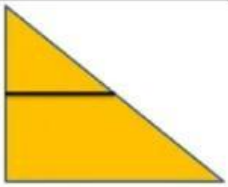		

Which is the correct fraction (half, quarter) of shape ?

	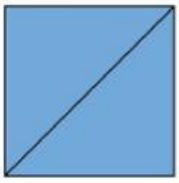	

LIVEWORKSHEETS



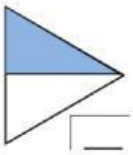

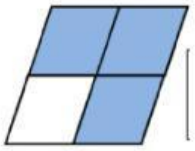

3. Shapes and symmetry

Choose the correct name of the shapes

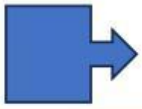

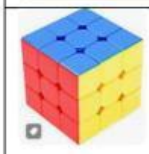

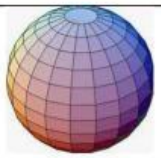

LIVEWORKSHEETS

Tick the shape that have a correct vertical line of symmetry

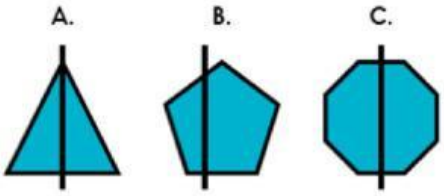

Peter has completed the table beside. Is he correct ? Can you explain ?

Correct. ☐

Incorrect. ☐

Vertical line of symmetry	No vertical line of symmetry
A.	C.
B. 	D.

Draw lines of the symmetry

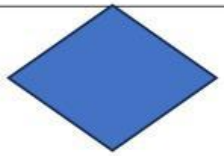	
	5
8	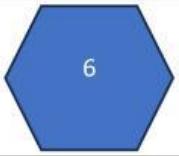 6

LIVEWORKSHEETS

4. Summary

	This shape is _r_____le. It has ____ sides and ___ corners.
	This shape is p_____on. It has _____ sides and _____ corners.
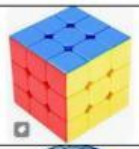	This shape is c____ . It has 8 v_____ies and 8 f____es.
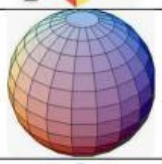	This shape is sp_____ . It has _____ vertices and ____ faces.
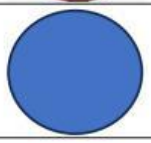	This shape is c_____. It has _____ sides and ____ corners.

LIVEWORKSHEETS