PDF-XChange Product
Click to buy NOW!
www.tracker-software.com

PRIMARY MATHEMATICS LEVEL 2 – 2ND TERM FINAL TEST

Name: _____

Class: _____

I. Numbers to 100

Which is the missing digit of the given number ?

Given number: Elevent 1	Given number: Eighteen 1	Given number: fifteen 1
Given number: thirty-seven 7	Given number: twenty-eight 8	Given number: fourty-three
Given number: fifty-nine 9	Given number: seventy-one	Given number: ninety-six

What is the **place-holder digit** of the given number

Given number: fourty-eight 4	Given number: fifty-seven 5	Given number: eighteen 1
Given number: thirteen 1	Given number: sixty-five 6	Given number: one-hundred 1 0

Complete the row

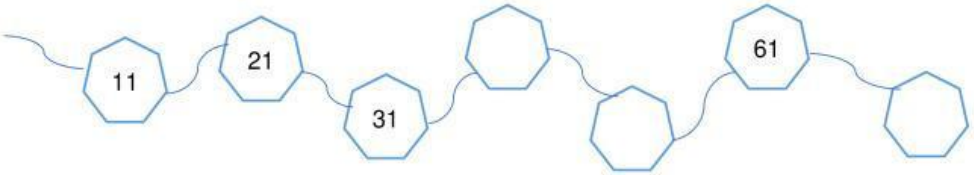

Complete the column and row within Sudoku game:

LIVEWORKSHEETS

	6			5	
					1
		4	6		5
5		6	2		
6					
	1			2	

II. Counting up to 100 objects

<Let the kid counting up to 100 objects>

III. Compare and ordering numbers
https://www.liveworksheets.com/w/en/math/373172

IV. Geometry

1. 3D Shapes
Choose the correct describe about red-highlighted objects in the given picture

		

LIVEWORKSHEETS

PDF-XChange Product
Click to buy NOW!
www.tracker-software.com





2. Fractions of shape

Which picture shows **equal parts** of shape ?



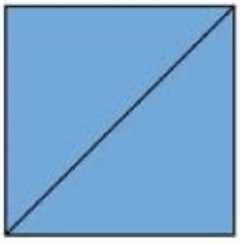

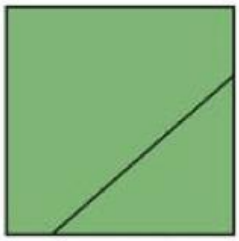

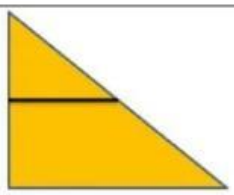





Choose the correct **fraction** of share ?

$\frac{2}{5}$

—

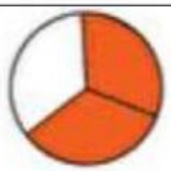

—

LIVEWORKSHEETS

PDF-XChange Product
Click to buy NOW!
www.tracker-software.com

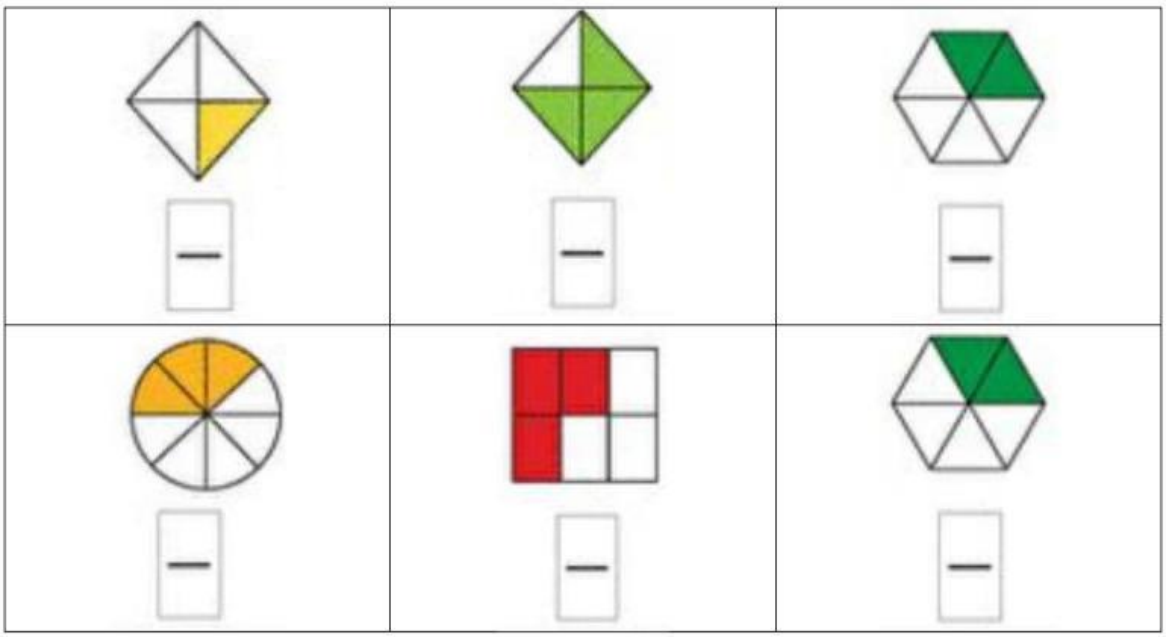

Which is the correct fraction (half, quarter) of shape ?

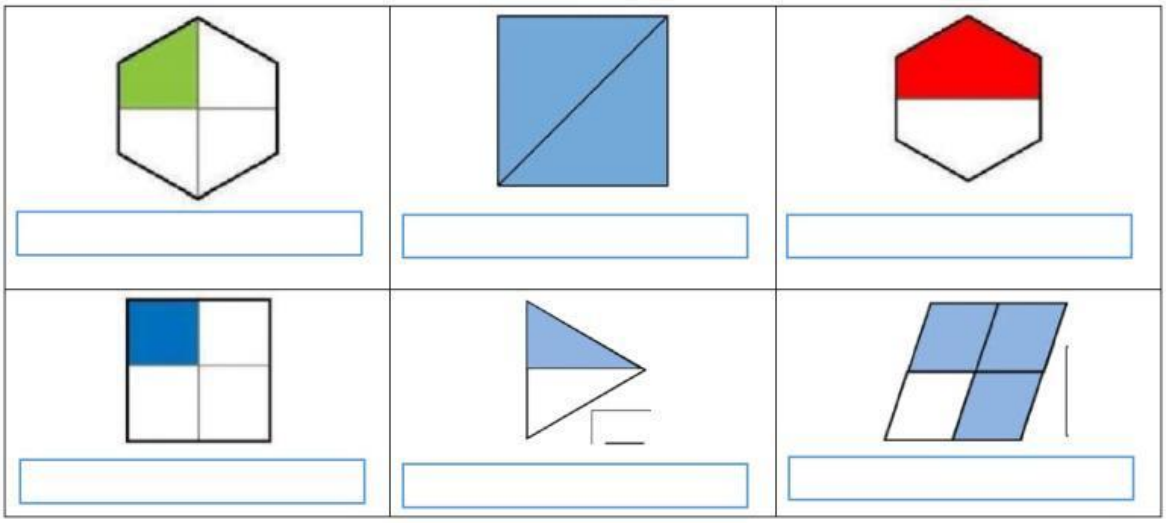

3. 2D shapes and symmetry

Choose the correct name of the shapes

LIVEWORKSHEETS

PDF-XChange Product Click to buy NOW! www.tracker-software.com

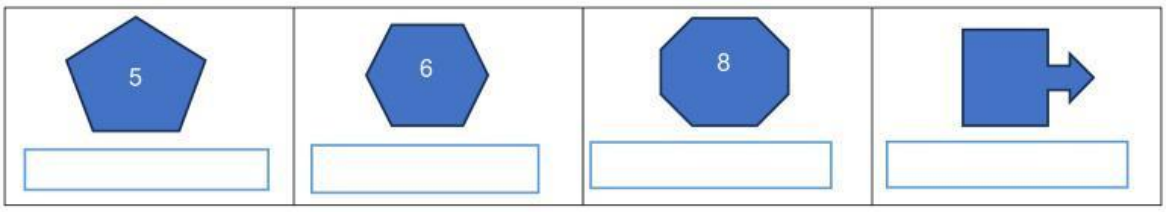

Which is the best *correct description* of the **red** line ?

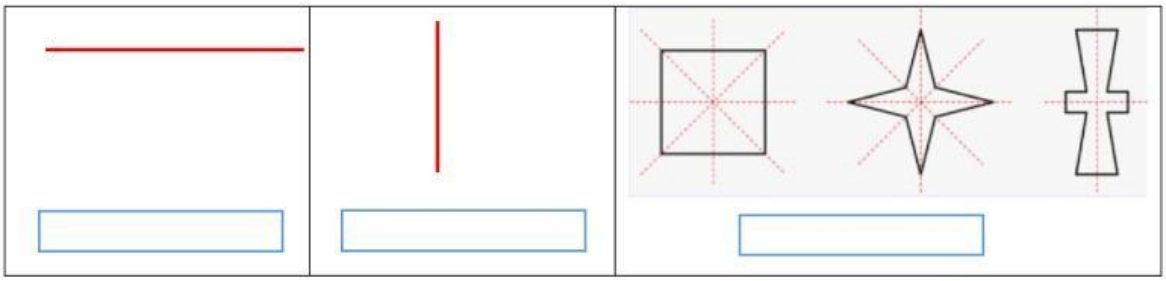

Tick the shape that have a correct vertical line of symmetry

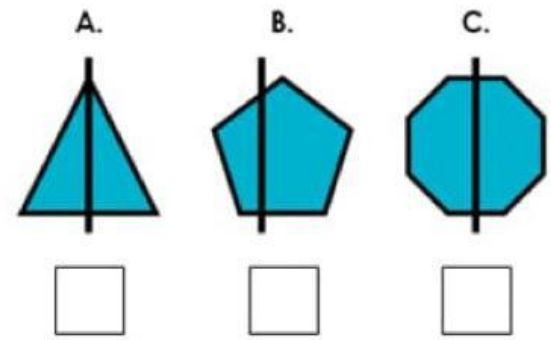

Peter has completed the table beside. Is he correct ? Can you explain ?

Correct. ☐

Incorrect. ☐

Vertical line of symmetry	No vertical line of symmetry
A.	C.
B. 	D.

LIVEWORKSHEETS